Centro Educativo en Computación San Bernabé

6to Primaria, Matemática

Segundo bimestre, Examen Parcial 2-4

Nombre: _____

Clave: _____ Fecha: _____

Instrucciones: Responde lo que en cada inciso se te solicite.

1. Encuentre el máximo común divisor del siguiente par de números.
   a. 21, 49_____
   b. 30, 66 _____
   c. 32, 81 _____
   d. 20, 35 _____
   e. 20, 32, 44 _____
2. Escriba 2 fracciones equivalentes a la fracción dada, puede simplificar o amplificar.
   a. 2/4 _____ _____
   b. 3/8 _____ _____
   c. 4/7_____ _____
3. Escriba la fracción en su mínima expresión.
   a. 24/48 _____
   b. 6/10 _____
   c. 32/40_____
4. Escriba como fracción o como decimal.
   a. ¾ _____
   b. 5/6 _____
   c. 4 ÷ 7 _____
   d. 8 ÷ 9_____
5. Escriba como decimal o como fracción decimal
   a. ¾ _____
   b. 13/20_____
   c. 9/1000_____
   d. 0.06 _____
   e. 0.35 _____
6. Escriba la fracción que se representa.

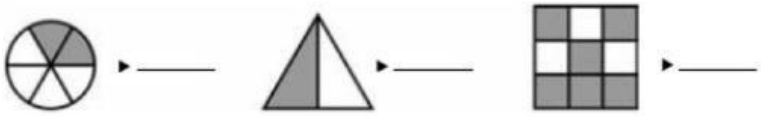

LIVEWORKSHEETS

a.

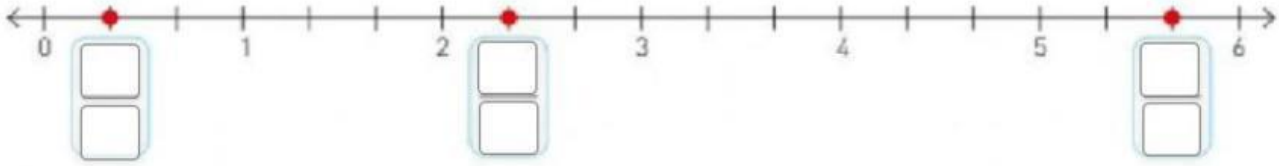

b.

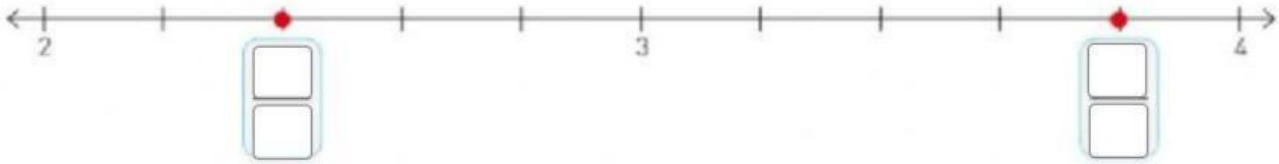

c.



7. Escriba como decimal y como fracción.



$\frac{\square}{10} = \square$



$\frac{\square}{10} = \square$



$\frac{\square}{10} = \square$



$\frac{\square}{100} = \square$



$\frac{\square}{100} = \square$

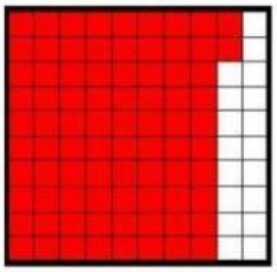

$\frac{\square}{100} = \square$

LIVEWORKSHEETS