Lembar Kerja Peserta Didik

LKPD

Mengenal Bangum Ruang

Nama :

Kelas :

LIVEWORKSHEETS

MENGENAL BAGUN DATAR

Ayo, perhatikan gambar bangun datar di sebelah kiri dan daftar ciri-cirinya di sebelah kanan!



- Tidak memiliki sudut
- Hanya memiliki 1 sisi lengkung
- Memiliki jari-jari dan diameter

- Memiliki 3 sisi dan 3 sudut
- Jenis: sama sisi, sama kaki, sembarang
- Jumlah sudut = 180°



- 4 sisi sama panjang
- 4 sudut siku-siku (90°)
- Semua sisi dan sudut sama besar

- Semua sisi sama panjang
- Diagonal saling tegak lurus
- Sudut berhadapan sama besar

- Hanya memiliki satu pasang sisi sejajar
- Bisa berbentuk sama kaki, siku-siku, atau sembarang

LIVEWORKSHEETS

MENCOCOKAN BANGUN DATAR

Hubungkanlah garis bangun datar sesuai namanya dibawah ini !



LINGKARAN

JAJAR GENJANG

SEGI TIGA

PERSEGI

LIVEWORKSHEETS

BANGUN RUANG

Tentukan banyak rusuk dan sisi dari bangun ruang di bawah ini!

1

Rusuk :

Sisi :

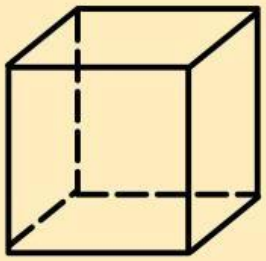

2

Rusuk :

Sisi :

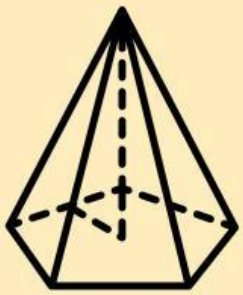

3

Rusuk :

Sisi :

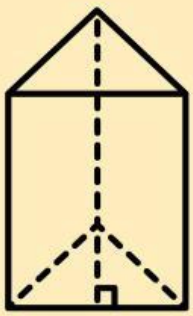

4

Rusuk :

Sisi :

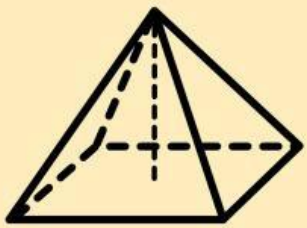

5

Rusuk :

Sisi :

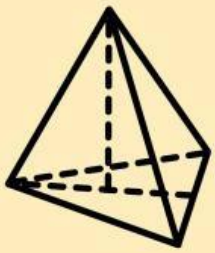

6

Rusuk :

Sisi :

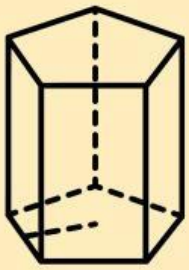

LIVEWORKSHEETS

Nama : Kelas :

Keliling dan Luas Bangun Datar

Hitunglah keliling dan luas bangun datar di bawah dengan benar!

Bangun Datar	Nama Jenis	Keliling	Luas
 12 cm			
15 cm 7cm			
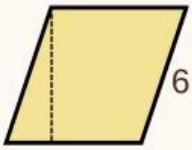 6 cm 10 cm			
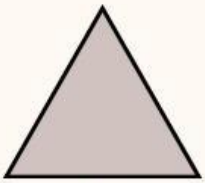 6 cm			
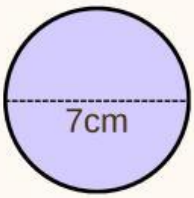 7cm			

LIVEWORKSHEETS