דף אינטראקטיבי בנושא מעגל ועיגול

גררו את שמות החלקים של המעגל למקום המתאים

ד.

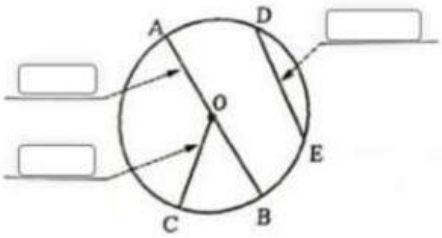

ג.

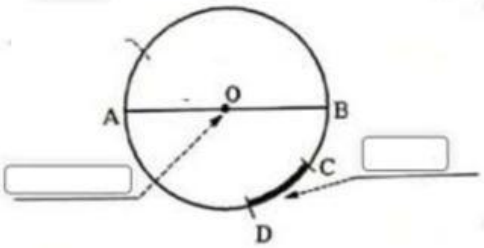

קשת | מיתר | רדיוס | קוטר | מרכז המעגל

מצאו את x בתרגילים הבאים. הנקודה המודגשת היא מרכז המעגל.

א.

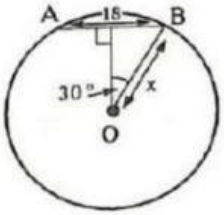

ב.

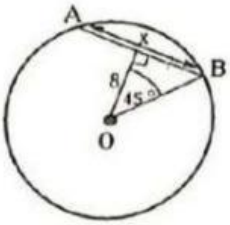

ג.

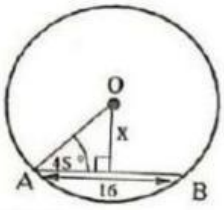

LIVEWORKSHEETS

מצאו את α ו-β . בחרו תשיבה נכונה בכל שאלה.

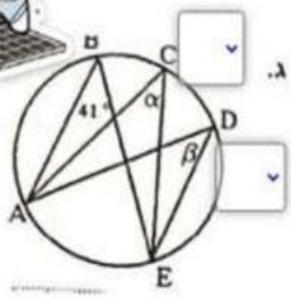

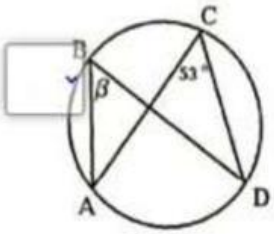

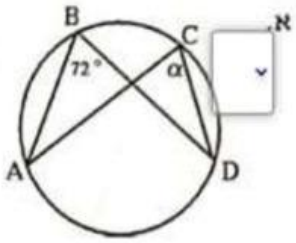

מצאו את α, אם ידוע כי AC הוא קוטר המעגל

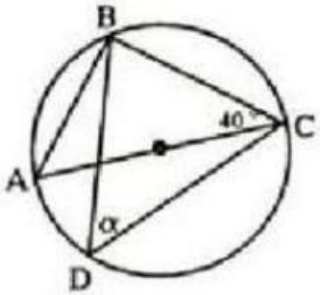

α = 40°

α = 50°

α = 25°

α = 20°

LIVEWORKSHEETS

מצאו את α בתרגילים הבאים. מתחו קו לתשובה המתאימה.

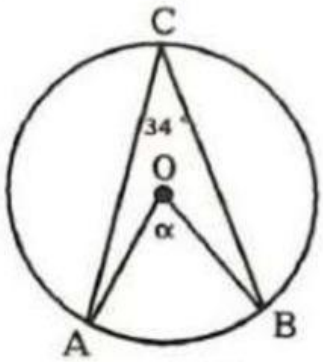

α = 25°

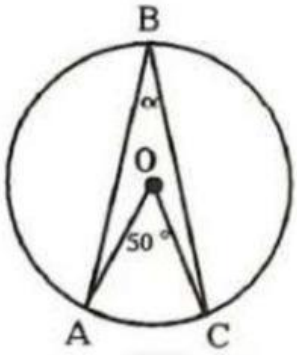

α = 68°

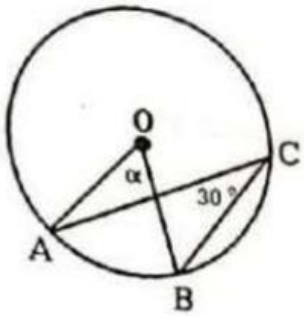

α = 60°

LIVEWORKSHEETS