LEMBAR KERJA PESERTA DIDIK (LKPD)

Nama :

No Absen :

1. Perhatikan gambar dan tentukan jenis transformasi apa yang paling tepat dari gambar yang berwarna merah menjadi warna biru atau sebaliknya. Tuliskan jawabanmu ada kotak yang telah disediakan.

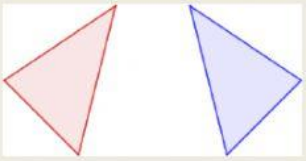	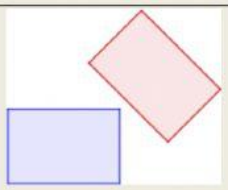
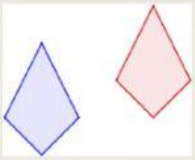	
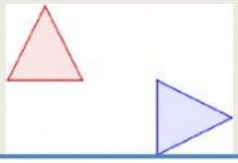	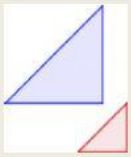

LIVEWORKSHEETS

2. Diketahui titik A (2,3) akan dicerminkan, tentukan bayangan dari titik A apabila dicerminkan sebagai berikut:

SUMBU X	(-2,3)
SUMBU Y	(3,2)
GARIS y = x	(2,-3)
GARIS y = -x	(-3,-2)

SERDANLEPASGAMBARBANGUNKEGARISYANGTELAHDISEDIAKANDENGAN BENAR

3. Geser dan lepas gambar bangun berikut pada kotak yang telah disediakan dengan benar!

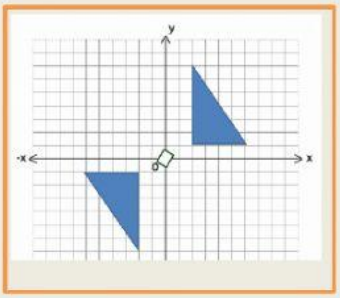

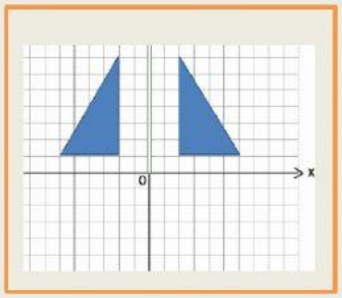

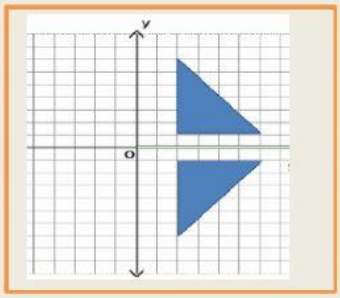

Pencerminan terhadap sumbu x	Pencerminan terhadap sumbu y	Pencerminan terhadap titik pusat (0,0)

LIVEWORKSHEETS