Name :

Class :

WHICH HAS MORE TOYS?

Count the toys in each box. Put a checkmark on the circle which has more toys







LIVEWORKSHEETS