Matematik Tahun 2

NAMA: _____ TARIKH: _____

ARAHAN: Padankan ciri-ciri objek yang sepadan dengan betul.

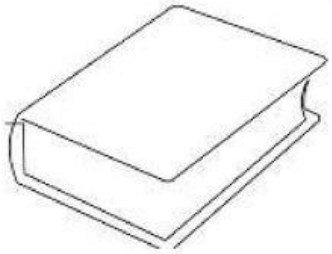

tebal



pendek

panjang

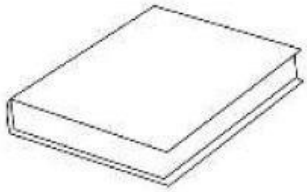

nipis

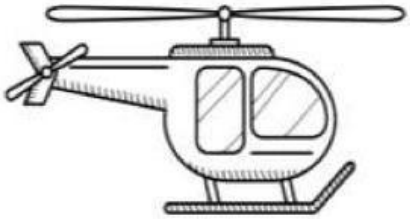

berat

rendah



tinggi

ringan

LIVEWORKSHEETS