Họ và tên: _____ Ngày: _____

1. Thực hiện cây liên kết để tìm ra số còn thiếu

10 - __ = 6



8 - __ = 3



10 - __ = 8



10 - __ = 3



8 - __ = 2



5 - __ = 2

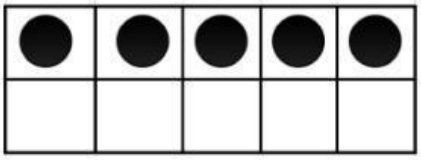

9 - __ = 1



3 - __ = 1

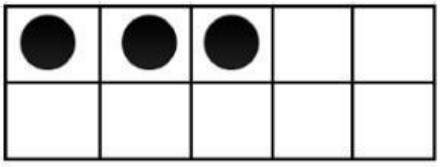

9 - __ = 4



5 - __ = 3

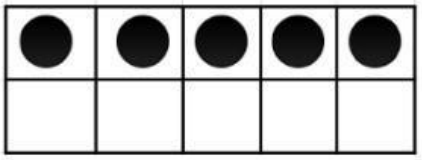

LIVEWORKSHEETS

1. Hoàn thành cây liên kết sau



LIVEWORKSHEETS