Name: _____ Date: _____

Circle Worksheet

1 a.

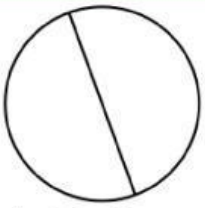

$d = 3.2$ yd

Calculate the circumference of the circle.

1 b.

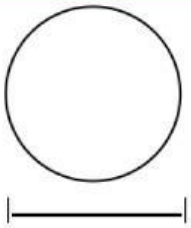

$d = 6.7$ in

Calculate the circumference of the circle.

2 a.

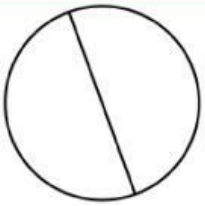

$d = 7.2$ cm

Calculate the circumference of the circle.

2 b.

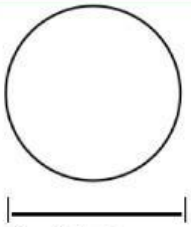

$d = 4.8$ m

Calculate the circumference of the circle.

3 a.

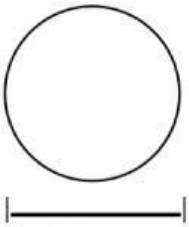

$d = 3.9$ cm

Calculate the circumference of the circle.

3 b.

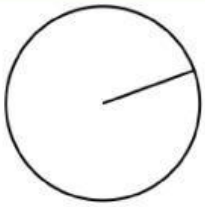

$r = 2.7$ mm

Calculate the circumference of the circle.

Copyright Homeschoolmath.net - **www.HomeschoolMath.net/worksheets**. *Permission to copy:* You are free to copy this worksheet to any number of students for their mathematics work. Do not distribute on websites, books, or any such material without permission.

LIVEWORKSHEETS