# أكمل الفراغ للكسور المتكافئة التالية

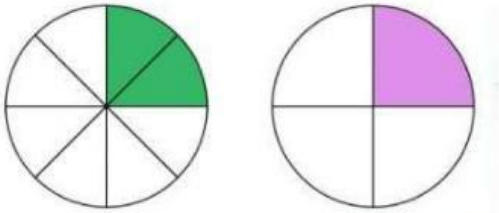

$\frac{2}{\square} = \frac{1}{4}$

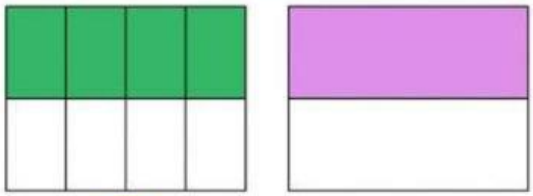

$\frac{\square}{\square} = \frac{1}{2}$

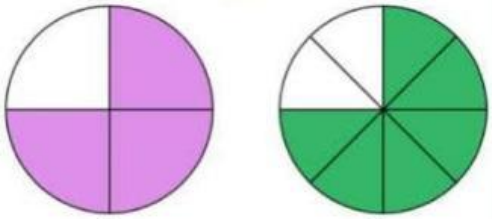

$\frac{3}{4} = \frac{6}{\square}$

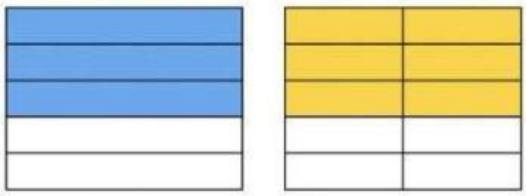

$\frac{\square}{5} = \frac{6}{10}$

معلمتك نورالهدى

LIVEWORKSHEETS