For this activity, we have to write down the shape, number of faces, vertices and edges we see in the meteorites.

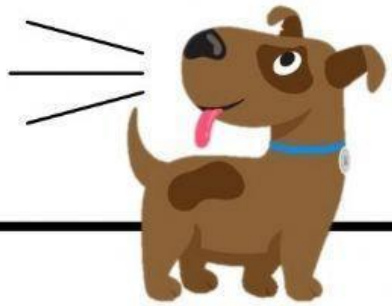



Shape:

Faces:

Vertices:

Edges:

Shape:

Faces:

Vertices:

Edges:

Shape:

Faces:

Vertices:

Edges:

Shape:

Faces:

Vertices:

Edges:



Shape:

Faces:

Vertices:

Edges:

Cone

Cube

Sphere

Pyramid

Cylinder

LIVEWORKSHEETS