SO SÁNH VÀ SẮP XẾP PHẠM VI 10

Họ và tên: _____ Ngày: _____

Câu 1. Điền số còn thiếu trên các trục số sau

A)

B)



C)

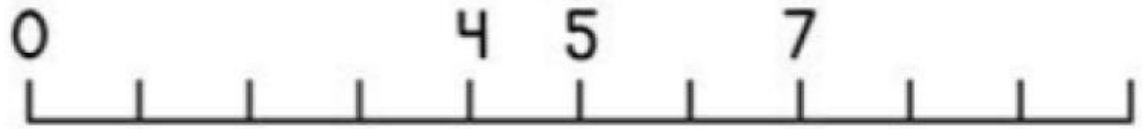

Câu 2. Tick vào những phép so sánh đúng

5 > 8 ☐	1 < 2 ☐	6 > 3 ☐
7 < 6 ☐	3 = 4 ☐	7 > 5 ☐
7 = 7 ☐	6 < 4 ☐	0 < 5 ☐
8 > 7 ☐	1 > 9 ☐	3 = 8 ☐
5 > 5 ☐	9 > 2 ☐	8 < 8 ☐

LIVEWORKSHEETS

Câu 3. Thực hiện phép tính

3 + 1 = ☐

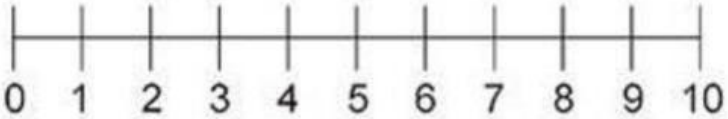

1 + 8 = ☐

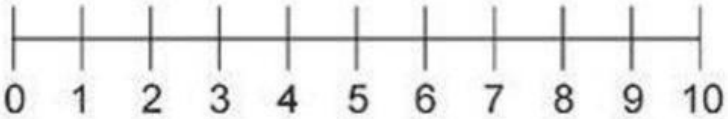

5 + 5 = ☐

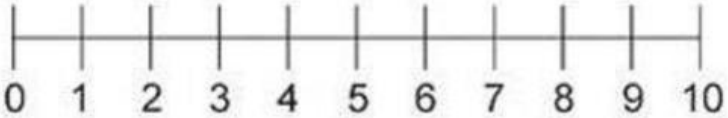

4 + 2 = ☐

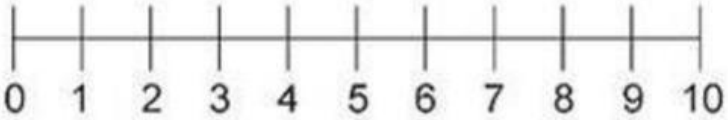

3 + 4 = ☐

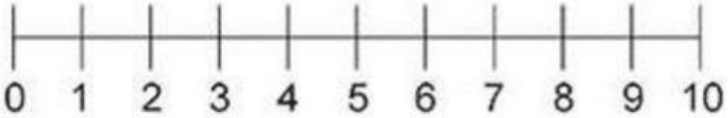

9 + 1 = ☐

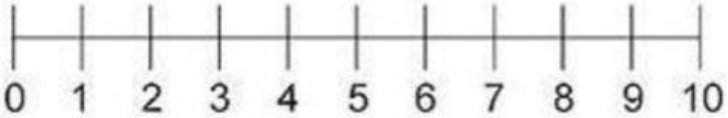

2 + 2 = ☐

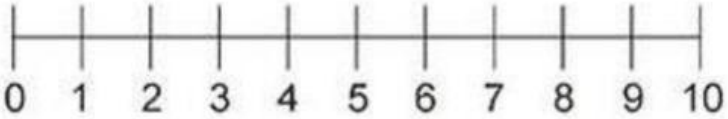

1 + 4 = ☐

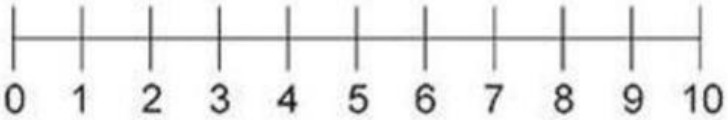

3 + 7 = ☐

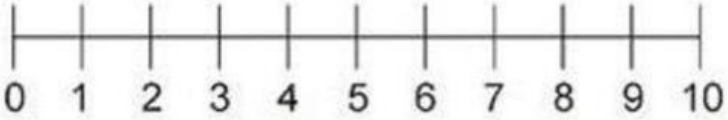

LIVEWORKSHEETS