A. Namakan pergerakan dalam gambar di bawah. Kemudian, lakukan. SP 1.1.1 SP 1.1.2 TP 1 TP 2

Berlari	Mengimbang	Berjalan
Naik tangga	Menyusup	Melompat

1.



2.



3.



Pergerakan

4.

5.



6.

LIVEWORKSHEETS

LIVEWORKSHEETS