LKPD

Latihan Soal Kelas VI Sekolah Dasar

Perkalian, membaca kalimat sederhana 2-3 kata, ciri-ciri benda padat, cair dan gas,

Nama : .....

Kelas : .....

LIVEWORKSHEETS

Nama:

Kelas:

PERKALIAN

Kerjakan hasil perkalian berikut ini menggunakan penjumlahan berulang.

3 x 5	=	5 + 5 + 5	=	15
5 x 1	=		=	
4 x 3	=		=	
2 x 7	=		=	
4 x 2	=		=	
5 x 3	=		=	
2 x 9	=		=	
1 x 3	=		=	

LIVEWORKSHEETS

HITUNG PERKALIAN

Hitung banyaknya benda dan tulis hasil perkaliannya.

Nama: _____ Kelas: _____ Absen No: _____

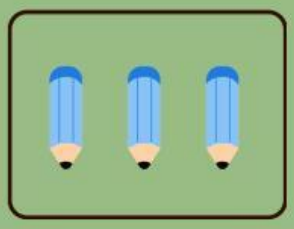

3 × 2 = ___

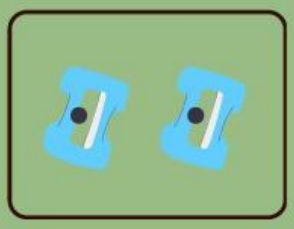

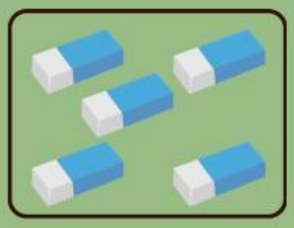

___ × ___ = ___



___ × ___ = ___

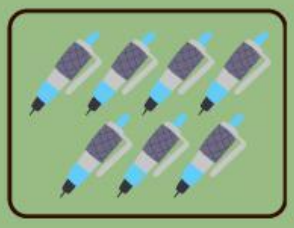

___ × ___ = ___

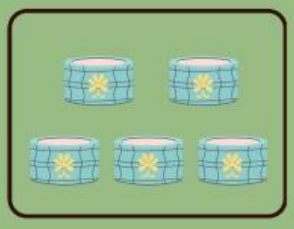



___ × ___ = ___

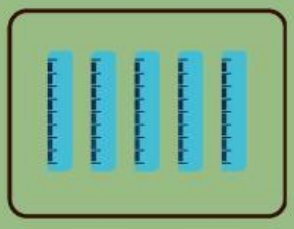

Penilaian *Masukan Guru* *Tanda Tangan*

☆☆☆☆☆ _____ _____

LIVEWORKSHEETS

Nama : Kelas :

PERKALIAN TIGA

Perkalian merupakan penjumlahan yang berulang. Kerjakanlah operasi hitung perkalian di bawah ini dengan benar!

1 × 3	=	1	+	1	+	1	=	3
2 × 3	=		+		+		=	
3 × 3	=		+		+		=	
4 × 3	=		+		+		=	
5 × 3	=		+		+		=	
6 × 3	=		+		+		=	
7 × 3	=		+		+		=	
8 × 3	=		+		+		=	

LIVEWORKSHEETS

MEMBACA

NAMA : .....

KELAS : .....

Lafalkan huruf yang terdapat pada kata-kata berikut

ROTI

RO - TI

R - O - T - I

RO - TI

ROTI

KUDA

KU - DA

K - U - D - A

KU - DA

KUDA

MEJA

ME - JA

M - E - J - A

ME - JA

MEJA

SAPI

SA - PI

S - A - P - I

SA - PI

SAPI

BUKU

BU - KU

B - U - K - U

BU - KU

BUKU

LIVEWORKSHEETS

Mari Mengeja Kata

Tebali dan tulis ulang kata di bawah dengan benar.

Ejaan : S-E-P-E-D-A

Tuliskan:

Ejaan : M-O-B-I-L

Tuliskan:

Ejaan : M-O-T-O-R

Tuliskan:

Ejaan : P-E-R-A-H-U

Tuliskan:

Ejaan : B-U-S

Tuliskan:

Nama Siswa: _____ **Absen No:** _____

Kelas: _____ **Penilaian:** ☆☆☆☆☆

LIVEWORKSHEETS

Nama: _____

Kelas: _____

Membaca Nyaring

Bacalah dengan nyaring kata-kata berikut!

buku	bola	palu
kaca	jala	kupu
biru	roda	lagu
batu	kuda	bata

LIVEWORKSHEETS

Nama: Absen:

Mengenal Wujud Benda

Berilah tanda silang (✕) pada jawaban yang benar, sesuai dengan contoh yang telah diberikan!

Gas | ~~Padat~~ | Cair

Gas | Padat | Cair

Gas | Padat | Cair

Gas | Padat | Cair

Gas | Padat | Cair

Gas | Padat | Cair

LIVEWORKSHEETS

Nama:

Kelas:

Wujud Zat

Klasifikasi benda-benda di bawah ke dalam kategori yang benar.

Padat	Cair	Gas



LIVEWORKSHEETS

Nama :

Kelas :

Perubahan Wujud Benda

Hubungkan gambar perubahan wujud benda di bawah ini dengan namanya!

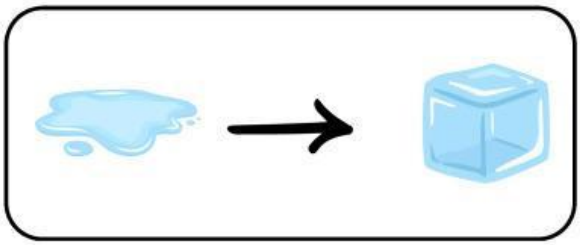

- Mengembun

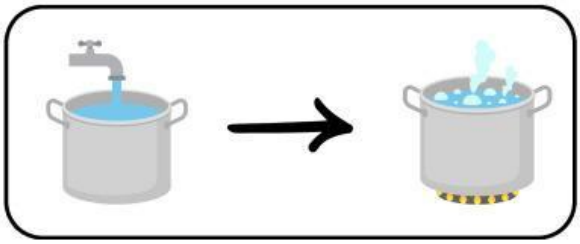

- Mencair

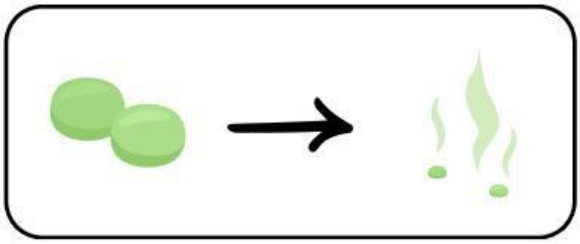

- Membeku

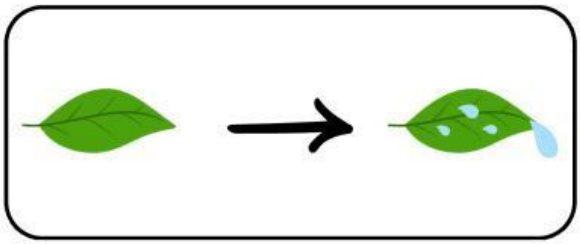

- Menyublim

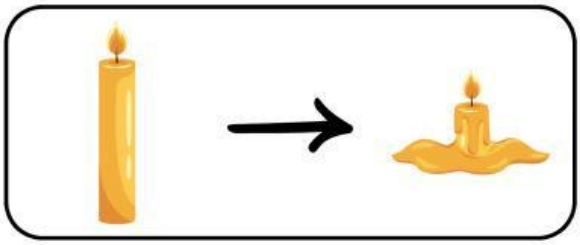

- Menguap

LIVEWORKSHEETS