Nama :

Kelas :

Mengurai Susunan Kubus

Hitung dan tulislah jumlah kubus pada susunan kubus berikut pada kotak kosong dengan tepat dan benar!



=



=



=

=



=

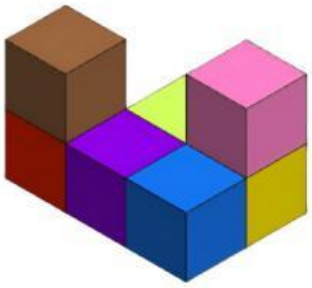

=



=

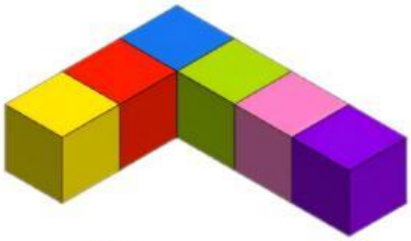

=

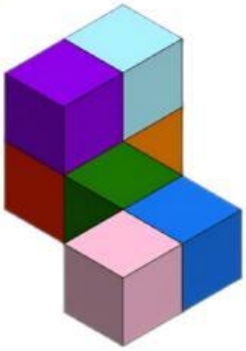

=



=

LIVEWORKSHEETS