Bangun Datar

PETUNJUK: Perhatikan gambar bangun datar di bawah kemudian tuliskan namanya!

LINGKARAN	TRAPESIUM	SEGI LIMA
PERSEGI	SEGI ENAM	SETENGAH LINGKARAN
SEGITIGA	JAJAR GENJANG	PERSEGI PANJANG



LIVEWORKSHEETS

Bangun Datar

PETUNJUK: Hubungkan gambar yang memiliki bentuk sama!

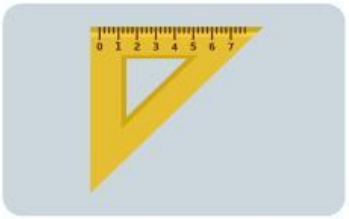

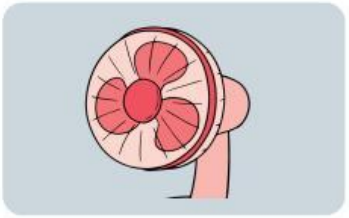

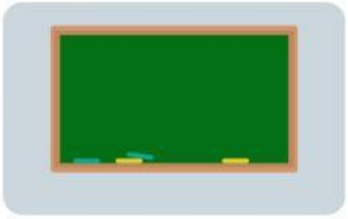

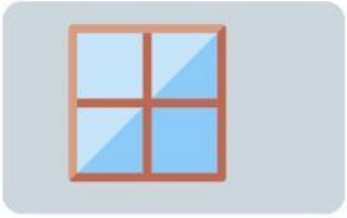

LIVEWORKSHEETS

Bangun Datar

PETUNJUK: Susunlah beberapa bangun datar di bawah agar dapat terbentuk sebuah rumah!

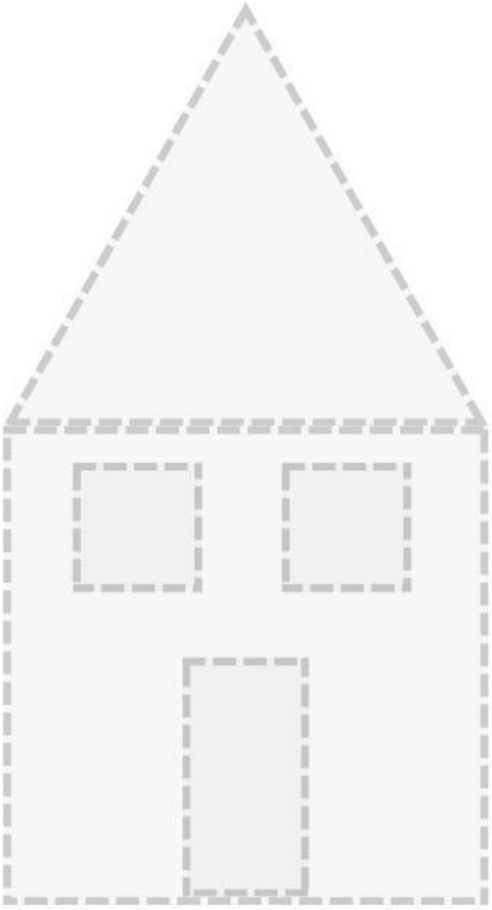

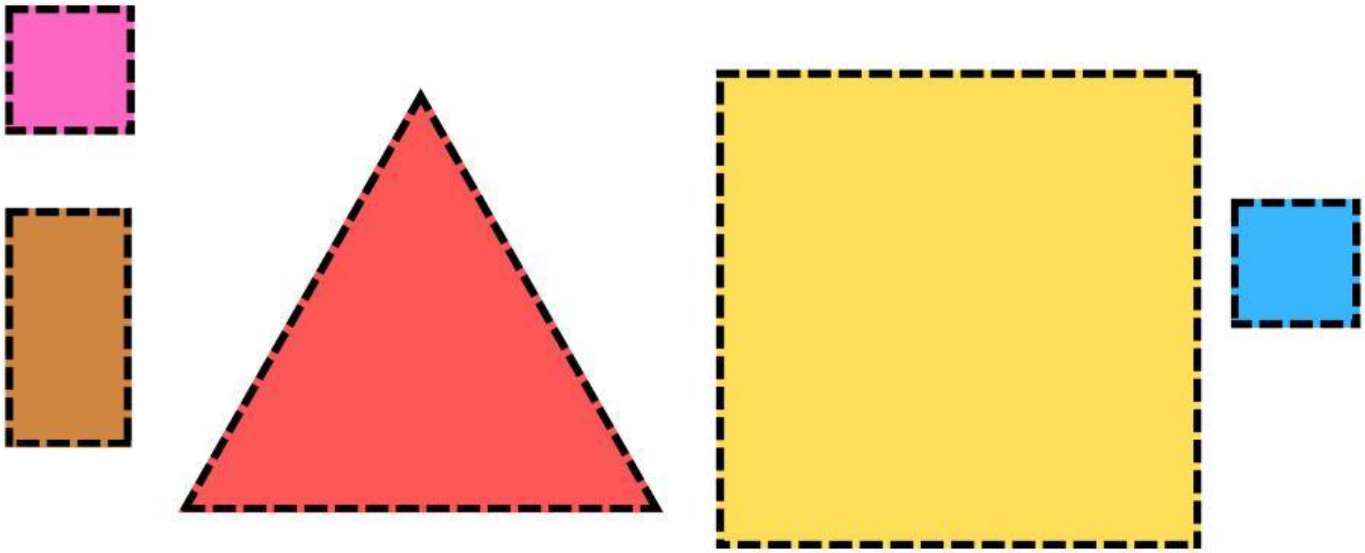

LIVEWORKSHEETS

Bangun Datar

PETUNJUK: Perhatikan gambar di bawah kemudian pilih dengan benar nama bangun datar yang terbentuk!

_____

_____

_____

_____

_____

_____

LIVEWORKSHEETS

Bangun Datar

PETUNJUK: Pilihlah angka yang benar sesuai dengan jumlah sisi tiap bangun datar!

4 5 6

4 6 8

2 3 4

3 4 6

6 7 8

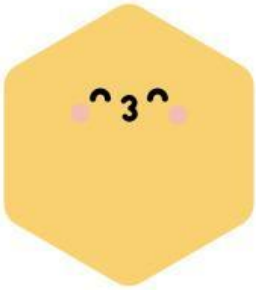

6 7 8

7 8 9

6 7 8

8 10 12

LIVEWORKSHEETS