PENJUMLAHAN

1. Ayo menghitung buah – buahan berikut !

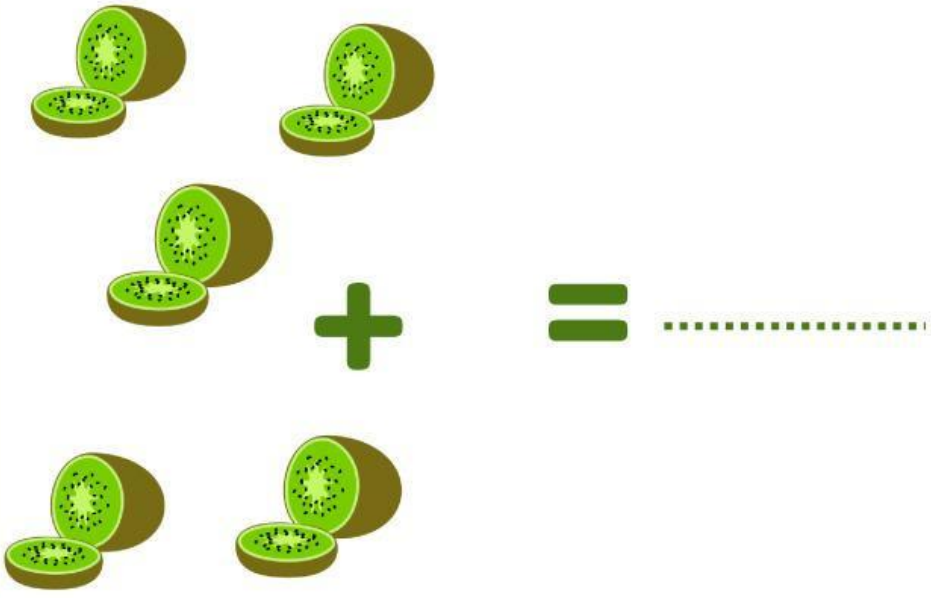

+ = ...

+ = ...

LIVEWORKSHEETS

PENGURANGAN

2. Fariski punya 6 buah apel di makan 3 sisa berapa buah fariski sekarang?



LIVEWORKSHEETS

PENJUMLAHAN

3. nana punya 4 anggur di tas dan 1 anggur di kantong bajunya berapakah anggurnya nana?

A

B

C

LIVEWORKSHEETS

PENGURANGAN

4. Tarik garis dari pengurangan ke hasil yang tepat!



LIVEWORKSHEETS

PENJUMLAHAN

5. Pilihlah buah-buahan berikut yang jumlahnya 3





LIVEWORKSHEETS