Kurikulum Merdeka | MERDEKA BELAJAR | Merdeka Mengajar

Lembar Kerja Peserta Didik

LKPD

MATEMATIKA KELAS 2

PENJUMLAHAN BILANGAN

Nama :

Kelas :

No. Absen :

LIVEWORKSHEETS

Nama : Kelas :

OPERASI PENJUMLAHAN DENGAN CARA MENGHITUNG MAJU

Hitunglah operasi penjumlahan berikut dengan menghitung maju.

10 11 12 13 14 15 16 17 18 19 20

10 + 6 =

12 + 4 =

15 + 4 =

15 + 4 =

11 + 6 =

10 + 9 =

14 + 3 =

12 + 6 =

15 + 5 =

13 + 6 =

LIVEWORKSHEETS

PASANGAN BILANGAN

Tuliskan pasangan bilangan yang sesuai.

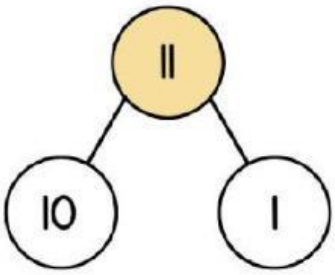

10 + 1 = 11

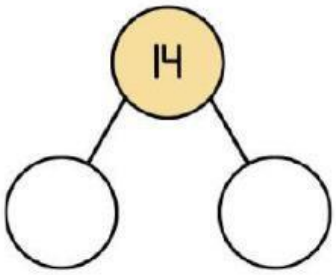

_____

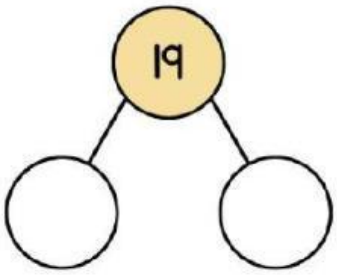

_____

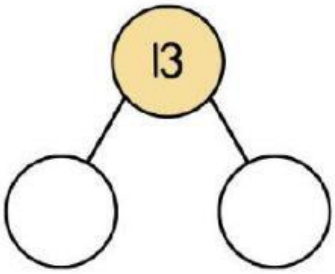

_____

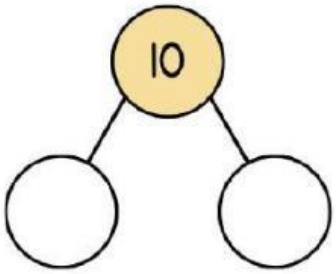

_____

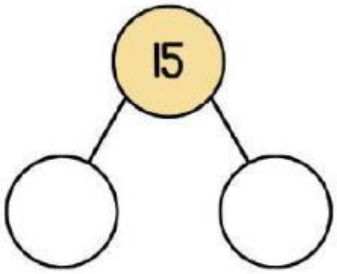

_____

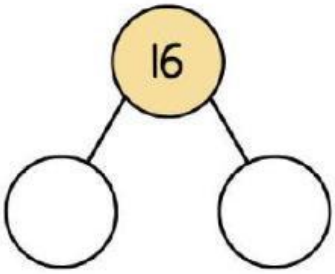

_____

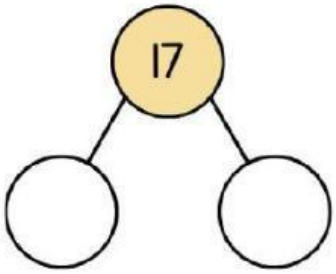

_____

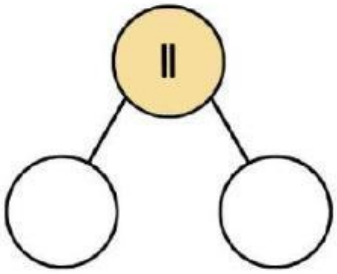

_____

LIVEWORKSHEETS

Nama : Tanggal :

AYO BERHITUNG

Hitunglah hasil dari operasi penjumlahan dibawah ini dengan benar!

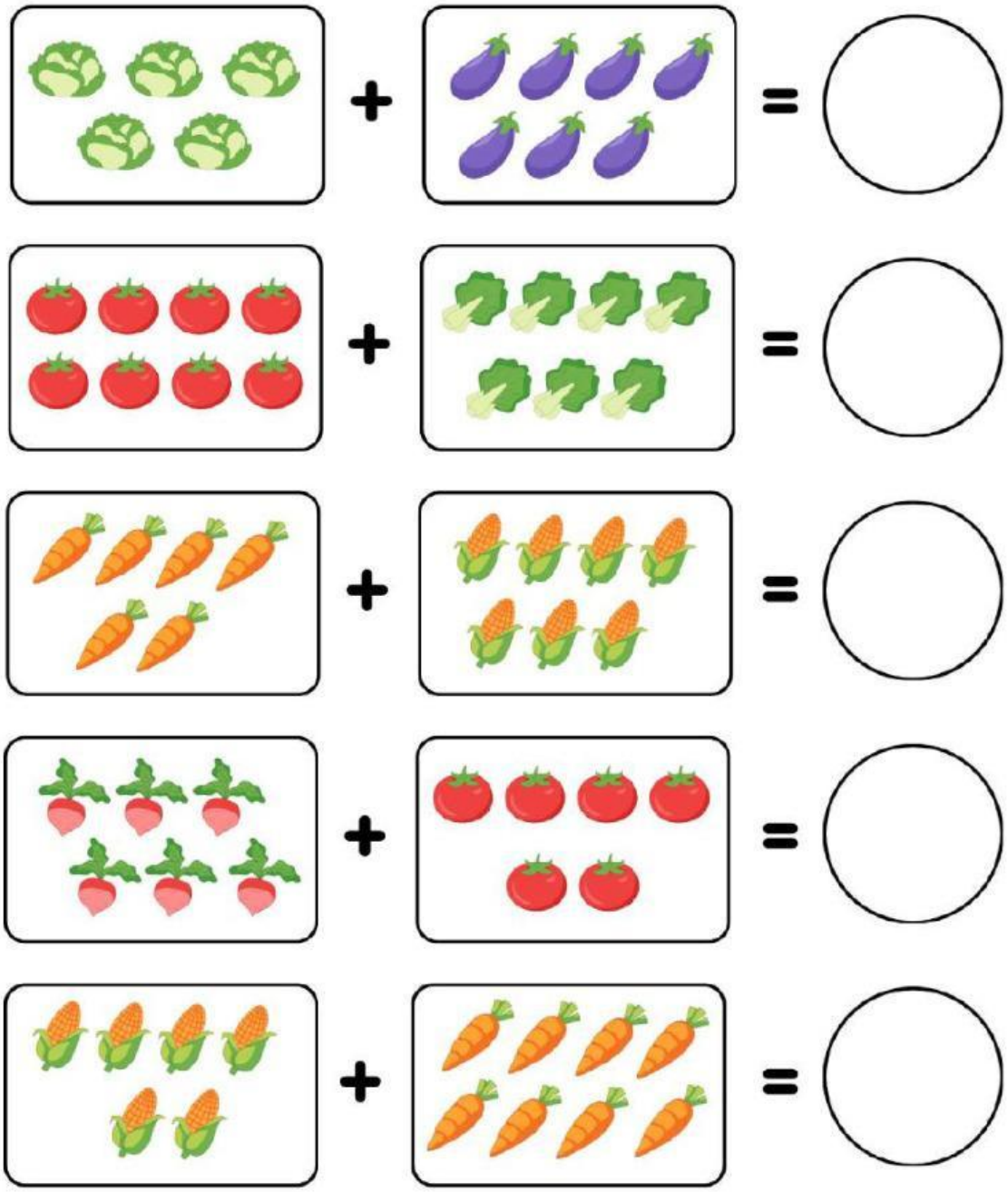

LIVEWORKSHEETS

Nama: Kelas:

Penjumlahan Bersusun

Tentukan jumlah dari soal di bawah ini dan catat hasilnya.

10 2 +	15 4 +	17 3 +	14 4 +
11 8 +	12 2 +	17 2 +	16 3 +
10 6 +	8 11 +	6 12 +	13 4 +

LIVEWORKSHEETS