Nama : _____ Kelas : _____

PECAHAN

Lingkari pecahan yang sesuai dengan bagian yang diarsir pada setiap bentuk dari pilihan yang tersedia.

1)		$\frac{1}{6}$	$\frac{3}{4}$	$\frac{2}{4}$	$\frac{3}{6}$	$\frac{2}{6}$
2)		$\frac{2}{7}$	$\frac{3}{8}$	$\frac{4}{7}$	$\frac{1}{5}$	$\frac{5}{7}$
3)		$\frac{3}{5}$	$\frac{4}{5}$	$\frac{5}{6}$	$\frac{3}{5}$	$\frac{4}{6}$
4)		$\frac{6}{8}$	$\frac{5}{6}$	$\frac{6}{4}$	$\frac{5}{8}$	$\frac{4}{6}$
5)		$\frac{1}{6}$	$\frac{2}{6}$	$\frac{2}{7}$	$\frac{3}{6}$	$\frac{2}{5}$
6)		$\frac{3}{8}$	$\frac{2}{6}$	$\frac{3}{3}$	$\frac{2}{8}$	$\frac{3}{6}$
7)		$\frac{1}{2}$	$\frac{2}{3}$	$\frac{1}{3}$	$\frac{2}{2}$	$\frac{2}{4}$
8)	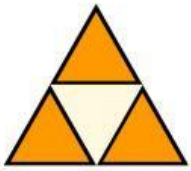	$\frac{3}{4}$	$\frac{1}{3}$	$\frac{2}{3}$	$\frac{2}{4}$	$\frac{3}{3}$
9)		$\frac{4}{8}$	$\frac{5}{7}$	$\frac{2}{8}$	$\frac{3}{7}$	$\frac{2}{7}$

LIVEWORKSHEETS

Nama : _____ Kelas : _____

Mengenal Pecahan

Warnailah bangun datar di bawah ini sesuai dengan bilangan pecahannya!

1. $\frac{1}{2}$ =

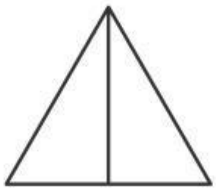

2. $\frac{2}{3}$ =

3. $\frac{2}{4}$ =

4. $\frac{4}{6}$ =

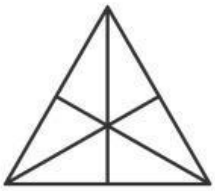

5. $\frac{3}{5}$ =

6. $\frac{6}{10}$ =



7. $\frac{1}{8}$ =

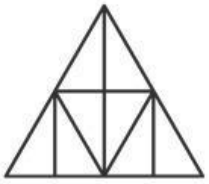

8. $\frac{3}{3}$ =

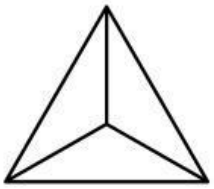

9. $\frac{5}{8}$ =

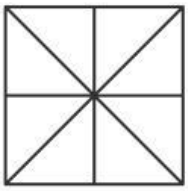

10. $\frac{7}{9}$ =

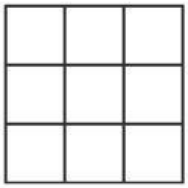

LIVEWORKSHEETS

Nama: Kelas:

MEMBANDINGKAN PECAHAN

Bandingkan pecahan berikut ini! Berilah tanda lebih besar (>), lebih kecil (<), atau sama dengan (=)!

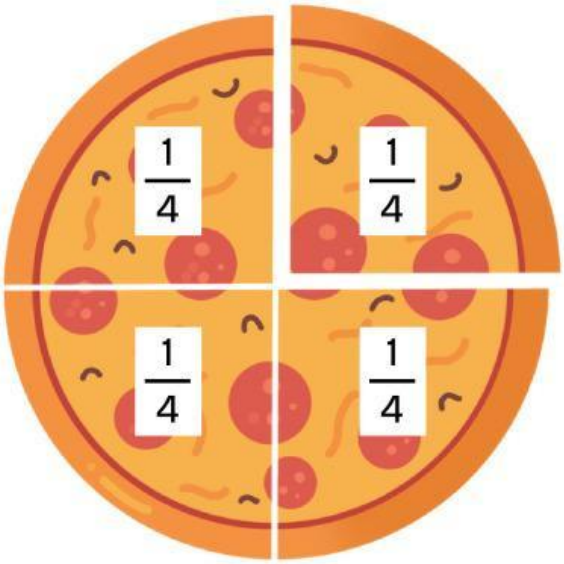

1. $\frac{1}{8}$ < $\frac{1}{4}$
2. $\frac{5}{8}$ ☐ $\frac{3}{4}$
3. $\frac{2}{8}$ ☐ $\frac{1}{4}$
4. $\frac{6}{8}$ ☐ $\frac{3}{4}$
5. $\frac{3}{8}$ ☐ $\frac{1}{4}$
6. $\frac{8}{8}$ ☐ $\frac{4}{4}$
7. $\frac{4}{8}$ ☐ $\frac{2}{4}$
8. $\frac{3}{8}$ ☐ $\frac{2}{4}$
9. $\frac{5}{8}$ ☐ $\frac{2}{4}$
10. $\frac{6}{8}$ ☐ $\frac{2}{4}$

LIVEWORKSHEETS