FRAZIONI EQUIVALENTI

1. SCRIVI LE FRAZIONI TRA LORO EQUIVALENTI

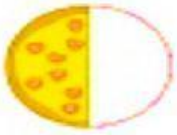

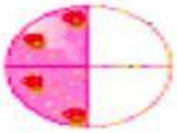

___ = ___



___ = ___

___ = ___ = ___



___ = ___ = ___

LIVEWORKSHEETS

2. ABBINA CORRETTAMENTE LE FRAZIONI

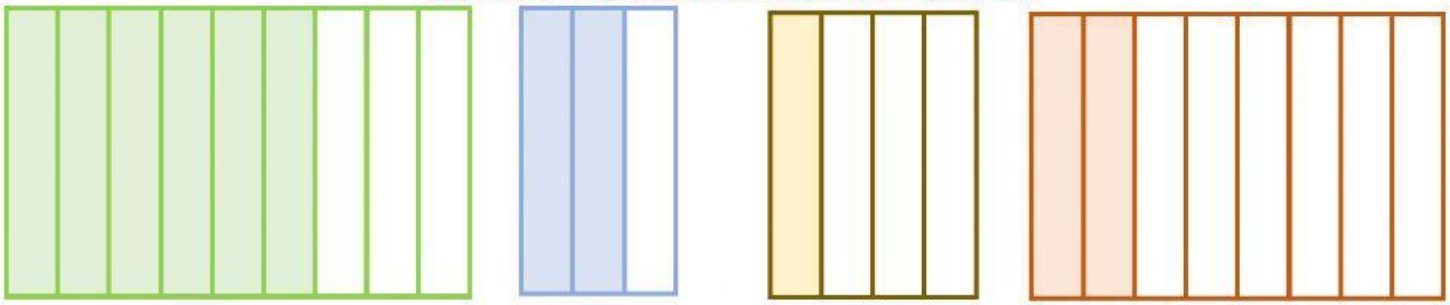

$\frac{1}{4}$ $\frac{6}{9}$ $\frac{2}{3}$ $\frac{2}{8}$

DUE/TERZI

TRE/OTTAVI

DUE/OTTAVI

SEI/NONI

LIVEWORKSHEETS

FRAZIONI COMPLEMENTARI

3. SCRIVI PRIMA LA FRAZIONE CHE CORRISPONDE ALLA PARTE COLORATA E POI LA SUA FRAZIONE COMPLEMENTARE

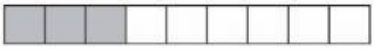	..... /	..... / .....
	..... /	..... / .....
	..... /	..... / .....
	..... /	..... / .....
	..... /	..... / .....
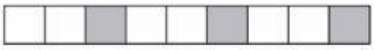	..... /	..... / .....
	..... /	..... / .....
	..... /	..... / .....

LIVEWORKSHEETS