Họ tên: _____ Lớp: 1_

PHIẾU LUYỆN MÔN TOÁN

Bài 1: Nhìn tranh và làm theo yêu cầu

a) Số ? (theo mẫu)



b) Đúng ghi Đ sai ghi S:

Số nhiều nhất ☐

Số ít nhất ☐

Số nhiều nhất ☐

Số ít nhất ☐

LIVEWORKSHEETS

Bài 2: Viết (theo mẫu)



4	<	8

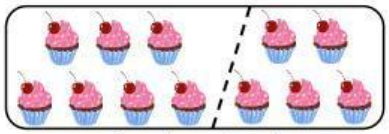







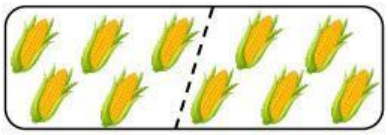

Bài 3: Viết các số sau: 8, 6, 2, 5

a, Theo thứ tự từ bé đến lớn:

.....

b, Theo thứ tự từ lớn đến bé:

.....

Bài 4: Vẽ thêm hoặc gạch bớt để có số hình bằng nhau (theo mẫu):

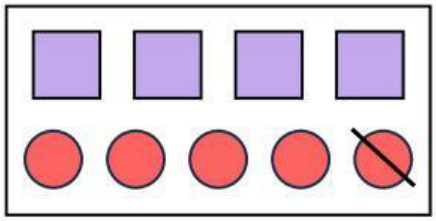

4 = 4

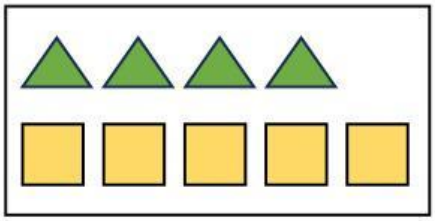

5 = 5

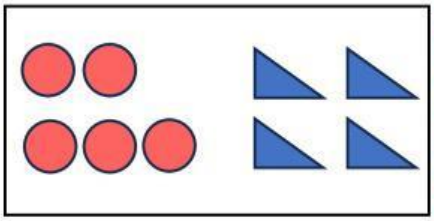

3 = 3

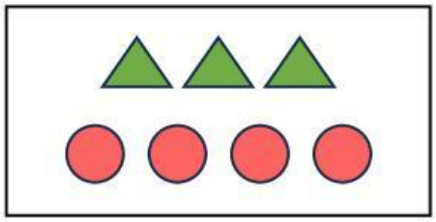

3 = 3

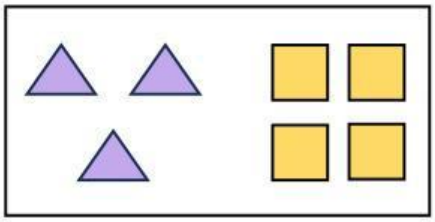

4 = 4

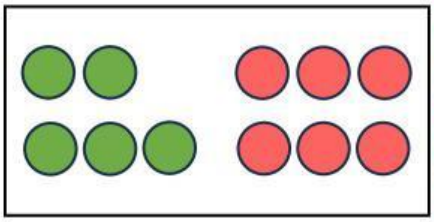

6 = 6

Bài 5: >, <, =

7 8	0 3	3 6	3 3
9 6	5 5	7 9	5 8

LIVEWORKSHEETS