Student's Name: _____ Date: _____

At Target Level

1. Which image shows the plant life cycle?

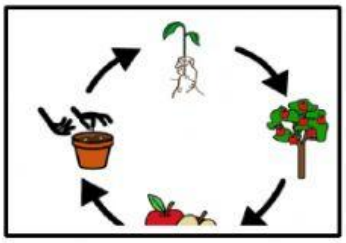



2. Plants and animals are both _____?





3. Identify the trait of an animal?

4. Where is the plant?




LIVEWORKSHEETS