@tadris_bazivar

کسرهای ریاضی

کسری را که نشان دهنده سایه هست را مشخص کنید.

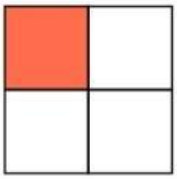

$\frac{۱}{۲}$ ☐ $\frac{۳}{۴}$ ☐ $\frac{۱}{۴}$ ☐ $\frac{۲}{۶}$

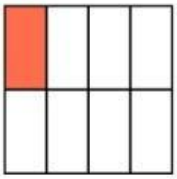

$\frac{۲}{۴}$ ☐ $\frac{۷}{۸}$ ☐ $\frac{۳}{۸}$ ☐ $\frac{۱}{۸}$

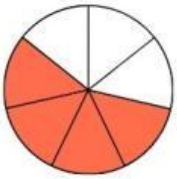

$\frac{۴}{۷}$ ☐ $\frac{۲}{۳}$ ☐ $\frac{۴}{۸}$ ☐ $\frac{۳}{۷}$

$\frac{۵}{۵}$ ☐ $\frac{۴}{۶}$ ☐ $\frac{۱}{۵}$ ☐ $\frac{۴}{۵}$



$\frac{۳}{۴}$ ☐ $\frac{۲}{۲}$ ☐ $\frac{۱}{۲}$ ☐ $\frac{۱}{۴}$

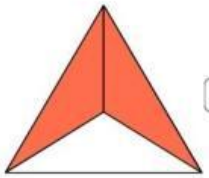

$\frac{۲}{۳}$ ☐ $\frac{۱}{۳}$ ☐ $\frac{۳}{۳}$ ☐ $\frac{۳}{۲}$

LIVEWORKSHEETS