Atividade de Matemática

Nome:
Turma = 9º ANO
Professor: José Oreste
Data:

① Leia as páginas 118 à 121 e responda as questões

a, Descubra os ângulos representado por letra nas figuras:

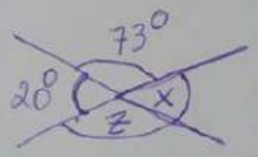

x = □° z = □°

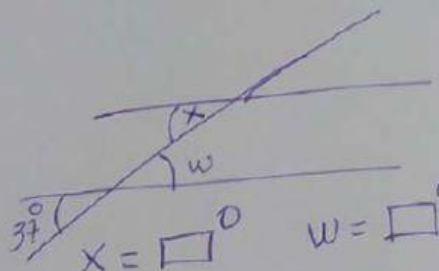

x = □° w = □°

Dica: Circunferência tem 360°

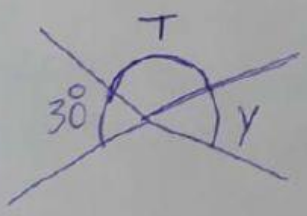

T = □° Y = □°

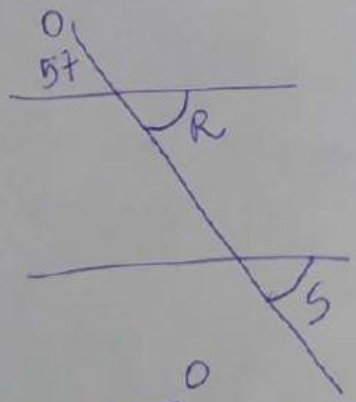

R = □° S = □°

LIVEWORKSHEETS

b, Classifique os ângulos em opostos, adjacentes e correspondentes

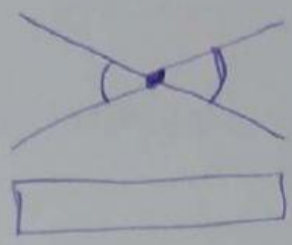

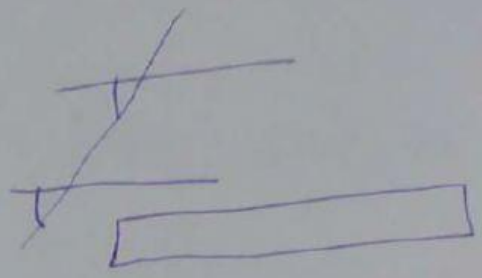



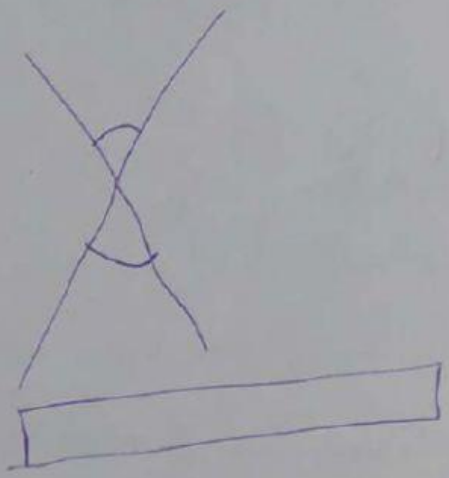

c, Determine o tamanho do ângulo das figuras a seguir = (coloque somente o número)

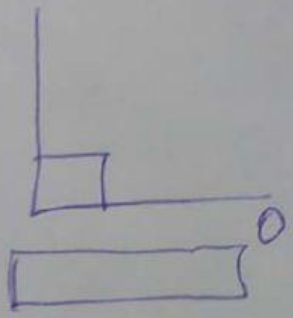

LIVEWORKSHEETS