Nama : Kelas :

POLA BILANGAN

Lanjutkan pola bilangan yang tertera pada masing-masing ulat!

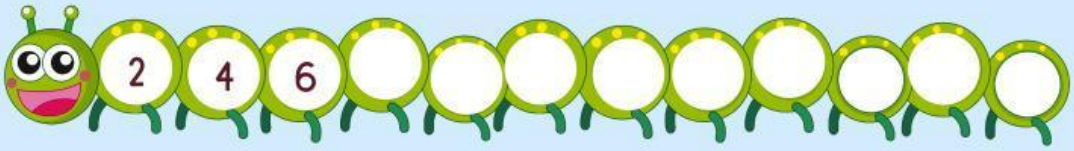



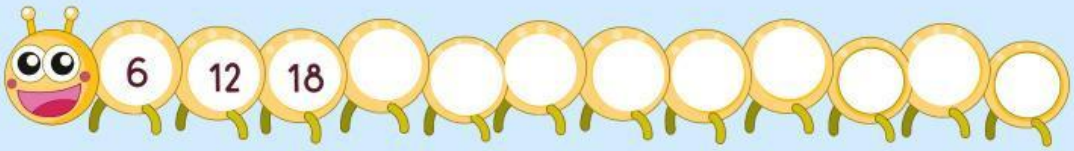

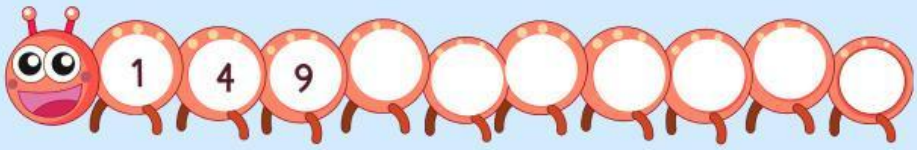

Apa yang dapat kalian simpulkan tentang pola bilangan?

.....

.....

.....

LIVEWORKSHEETS