Name: Score:

8 Multiple choice questions

Definition 1 of 8

AP= 4x + 10, PB = 42. Find x

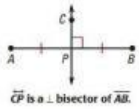

- -3
- 9
- 12
- 8

Definition 2 of 8

AP=x-2, BP=3x+4. Find x.

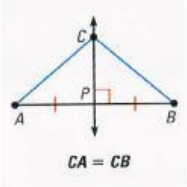

- 15
- -3
- 12
- 30

Definition 3 of 8

AB = 30, Find BP

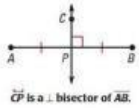

- 12
- 30
- 15
- -3

Definition 4 of 8

AP=12, Find PB.

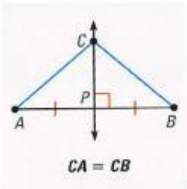

- 15
- -3
- 12
- 30

LIVEWORKSHEETS

Definition

5 of 8

AC=30, What is BC?

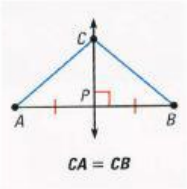

- 30
- 15
- 12
- -3

Definition

6 of 8

A line which cuts a line segment into two equal parts at 90°.

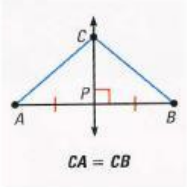

- 8
- Perpendicular Bisector
- 30
- 9

Definition

7 of 8

AP=3x-7, BP=2x+5. Find x.

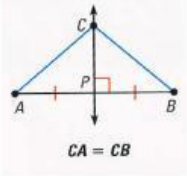

- 30
- 15
- -3
- 12

Definition

8 of 8

AD= 2x and DB = 18, what is x?

- 12
- 8
- 9
- -3

LIVEWORKSHEETS