Area and Perimeter of Irregular Shapes

Calculate the area and perimeter of the following shapes.

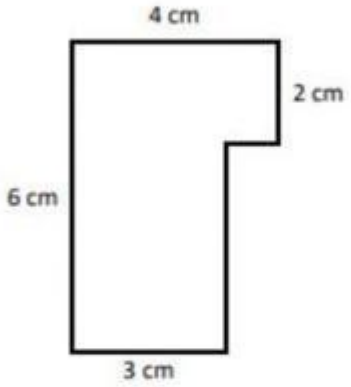

Area= _____ cm^2

Perimeter= _____ cm

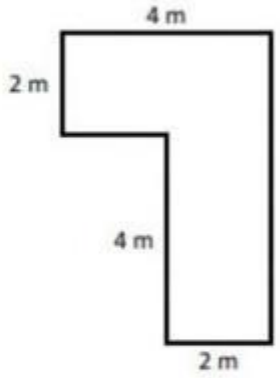

Area= _____ m^2

Perimeter= _____ m

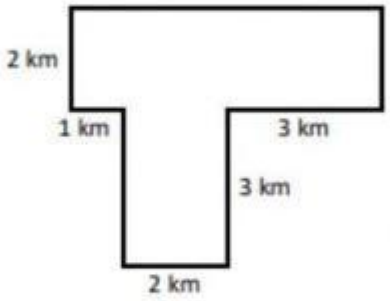

Area= _____ km^2

Perimeter= _____ km

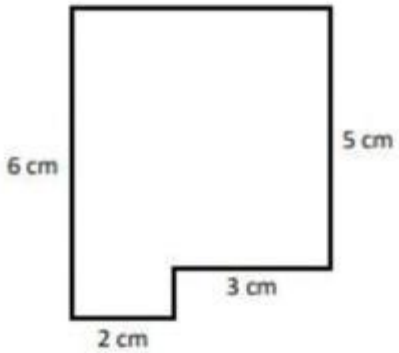

Area= _____ cm^2

Perimeter= _____ cm

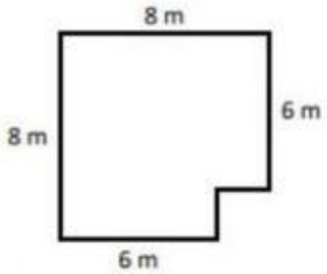

Area= _____ m^2

Perimeter= _____ m

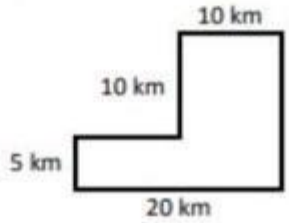

Area= _____ km^2

Perimeter= _____ km

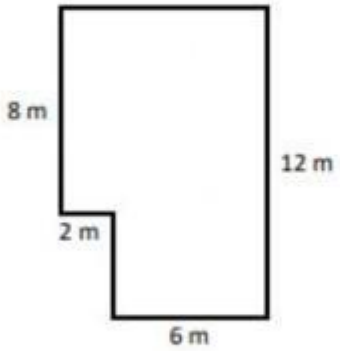

Area= _____ m^2

Perimeter= _____ m

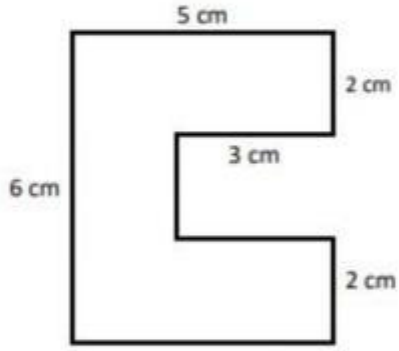

Area= _____ cm^2

Perimeter= _____ cm

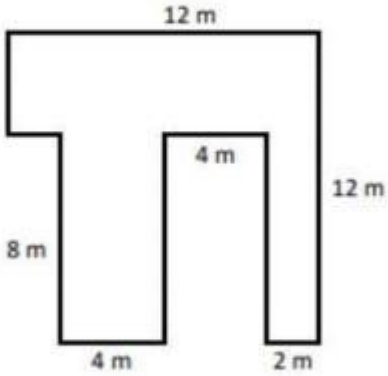

Area= _____ m^2

Perimeter= _____ m

LIVEWORKSHEETS