LKPD

Matematika

Tema:

Bangun Ruang

Nama: _____

Kelas: _____

LIVEWORKSHEETS

Bangun Ruang

Tulislah nama-nama bangun ruang di bawah ini.

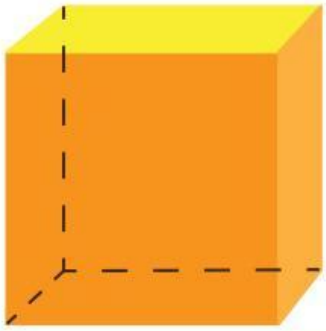

_____



_____



_____

_____

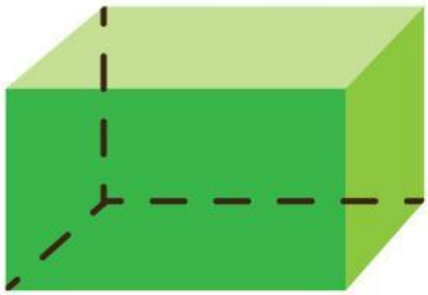

_____

LIVEWORKSHEETS

Bentuk Benda

Hubungkan benda dengan bentuknya.

Kerucut

Kubus

Balok

Bola

Tabung

LIVEWORKSHEETS

Bagian-bagian Bangun Ruang

Tuliskan banyak sisi, sudut, dan rusuk bangun ruang pada tabel di bawah ini.

No	Bangun Ruang	Bagian- bagian
1.	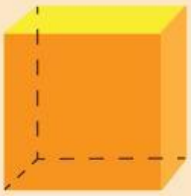	• Sisi: ____ • Sudut: ____ • Rusuk: ____
2.		• Sisi: ____ • Sudut: ____ • Rusuk: ____
3.		• Sisi: ____ • Sudut: ____ • Rusuk: ____
4.		• Sisi: ____ • Sudut: ____ • Rusuk: ____
5.	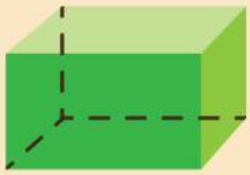	• Sisi: ____ • Sudut: ____ • Rusuk: ____

LIVEWORKSHEETS