Show my Understanding



$$\begin{array}{r} 8523 \\ +\ 790 \\ \hline \end{array} \qquad \begin{array}{r} 336 \\ \times\ 5 \\ \hline \end{array}$$

What are these fractions?

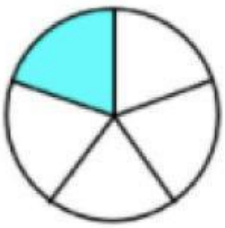

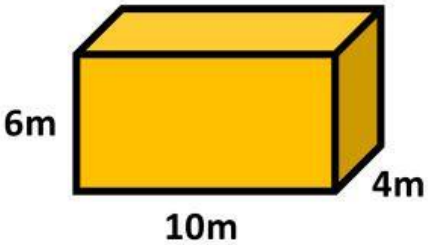

V = m^3

Number	Place Value	Total Value
7,382	Hundreds	300
4,567		
15.982		
45,986		
56.9		
0.875		

LIVEWORKSHEETS