SCRIVI IL NOME DELLA FIGURA GEOMETRICA PIANA E IL NUMERO DEI SUOI LATI

	
	
	

LIVEWORKSHEETS

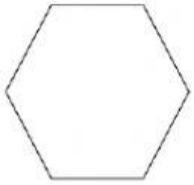	
	
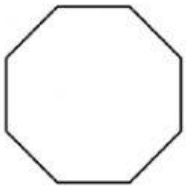	
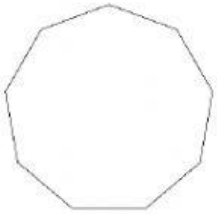	

I LATI SONO LE LINEE _____ _____

CHE DELIMITANO LE FIGURE GEOMETRICHE.

I PUNTI IN CUI SI INCONTRANO LE LINEE SPEZZATE, CIOE' I LATI, SI CHIAMANO

_____

LE SEGUENTI FIGURE GEOMETRICHE SONO TUTTE FIGURE _____

PERCHE' HANNO SOLO DUE DIMENSIONI: LUNGHEZZA E LARGHEZZA.

LIVEWORKSHEETS