LKPD

Matematika

Tema: Pola Gambar dan Pola BIlangan

Nama: _____

Kelas: _____

LIVEWORKSHEETS

Video Materi Pola Bilangan

PPT Materi Pola Bilangan

LIVEWORKSHEETS

Pola Gambar Berulang

Perhatikan bentuk geometri, gambarlah pola gambar berulang yang sesuai.



_____ _____



_____ _____

_____ _____



_____ _____



_____ _____

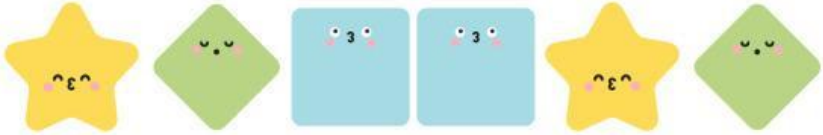

_____ _____

LIVEWORKSHEETS

Pola Gambar Bertumbuh dan Berkurang

Tulislah banyak benda selanjutnya sesuai pola gambar di bawah ini.

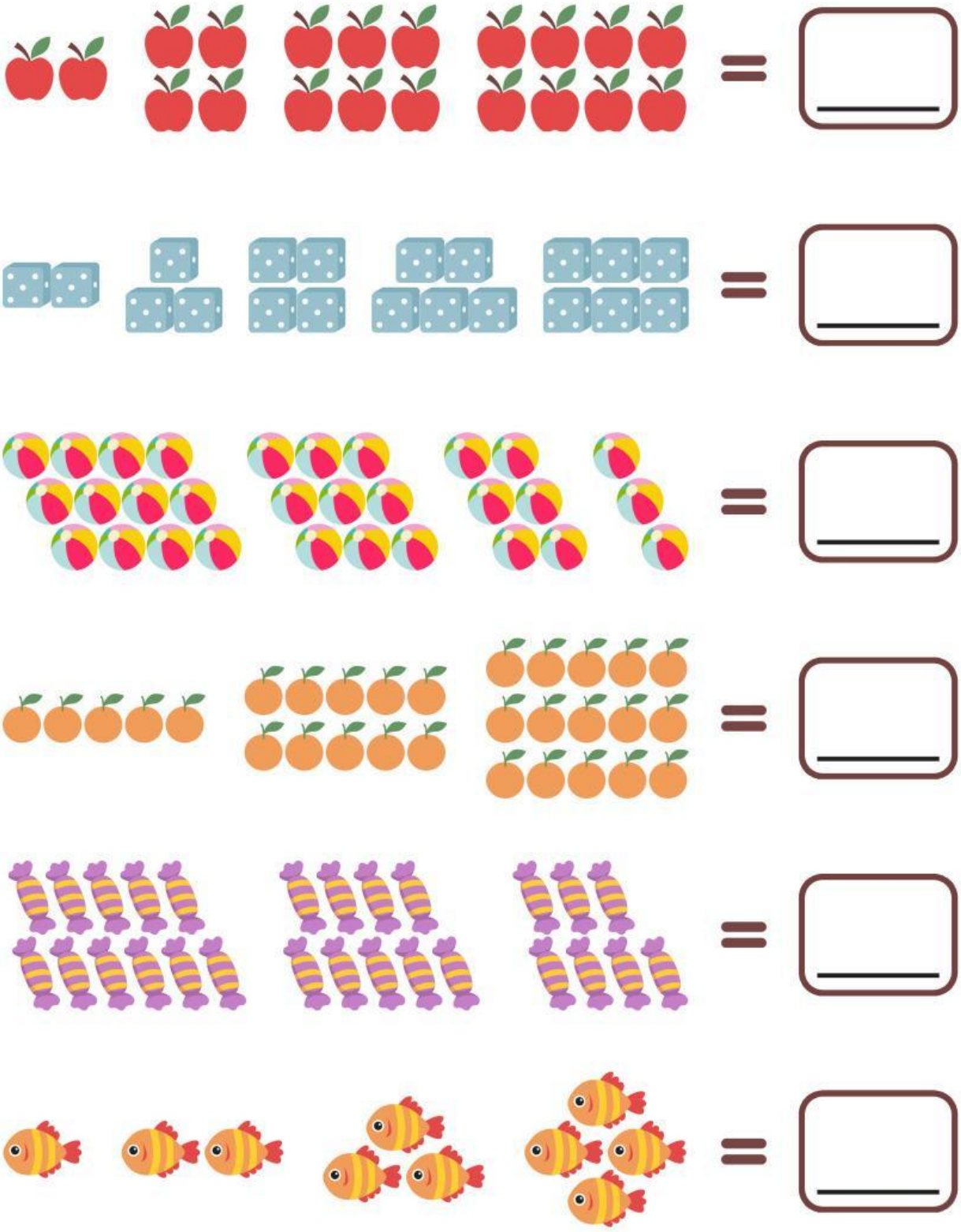

LIVEWORKSHEETS

Pola Bilangan

Lengkapilah pola bilangan di bawah ini.

1 3 ___ 7 ___

2 ___ 6 ___ ___

3 6 9 ___ ___

5 ___ 15 20 ___

24 ___ 16 ___ 8 4

100 90 ___ 70 ___ ___

LIVEWORKSHEETS