בס"ד

# תרגול שטח משולש

1. חשבו את השטח של המשולשים הבאים (שימו לב: נתון אחד מיותר):

א.

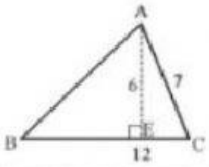


$S = \frac{\bullet}{2} =$

ב.

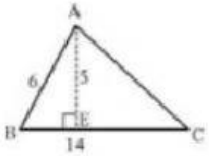


$S = \frac{\bullet}{2} =$

ג.

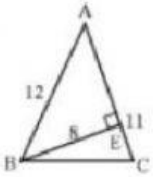


$S = \frac{\bullet}{2} =$

ד.

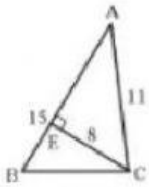


$S = \frac{\bullet}{2} =$

ה.

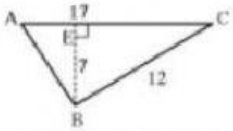


$S = \frac{\bullet}{2} =$

ו.

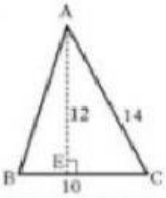


$S = \frac{\bullet}{2} =$

ז.

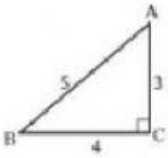


$S = \frac{\bullet}{2} =$

ח.

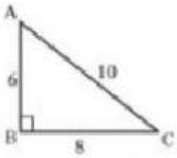


$S = \frac{\bullet}{2} =$

ט.

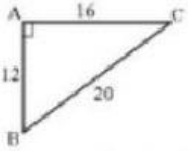


$S = \frac{\bullet}{2} =$

י.

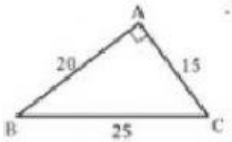


$S = \frac{\bullet}{2} =$

יא.

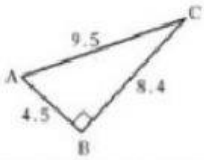


$S = \frac{\bullet}{2} =$

יב.

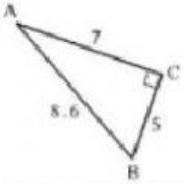


$S = \frac{\bullet}{2} =$

LIVEWORKSHEETS