Nama: Kelas: No Absen:

PENGURANGAN SEDERHANA

Hitunglah gambar di bawah ini lalu buatlah diagram batangnya.

4 - 2 =

3 - 2 =



5 - 3 =



7 - 4 =



9 - 6 =

12 - 9 =

Nilai	*Saran Guru*	*Paraf*
☆☆☆☆☆		

LIVEWORKSHEETS