LKPD

Nama :

Kelas :

No. Absen :

1. Beri tanda centang (√) pada jawaban yang benar!

3 buah jeruk

Lebih Banyak	
Lebih Sedikit	
Sama Banyak	

dari 11 buah jeruk

15 pensil

Lebih Banyak	
Lebih Sedikit	
Sama Banyak	

dari 7 pensil

7 buku

Lebih Banyak	
Lebih Sedikit	
Sama Banyak	

dengan 12 buku

LIVEWORKSHEETS



13 buah apel

Lebih Banyak	
Lebih Sedikit	
Sama Banyak	

dari 6 buah apel



11 donat stroberi

Lebih Banyak	
Lebih Sedikit	
Sama Banyak	

dengan 11 donat coklat

2. Isilah titik-titik dibawah ini dengan istilah lebih banyak,lebih sedikit, atau sama banyak!

a.





Jumlah pensil Ani ….
Jumlah pensil Doni …
Pensil Ani ……. pensil Doni.

b.

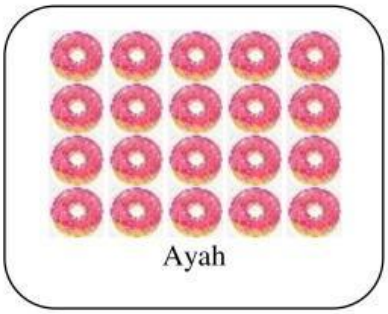

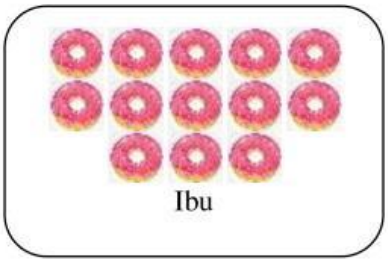

Jumlah donat Ayah ….
Jumlah donat Ibu ….
Donat Ayah ……. donat Ibu.

LIVEWORKSHEETS

c.

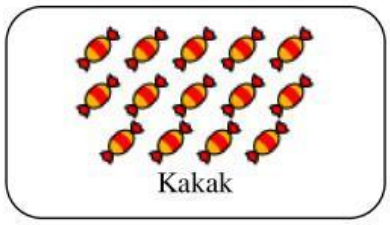

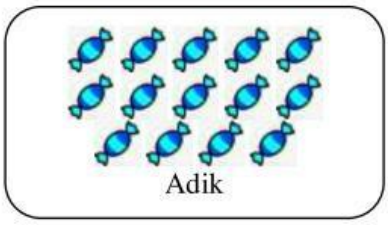

Jumlah permen kakak ….
Jumlah permen Adik ….
Permen Kakak ……. permen Adik.

d.



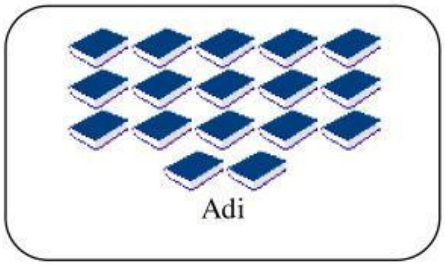

Jumlah buku Dion …
Jumlah buku Adi …
Buku Dion ……. buku Adi.

e.

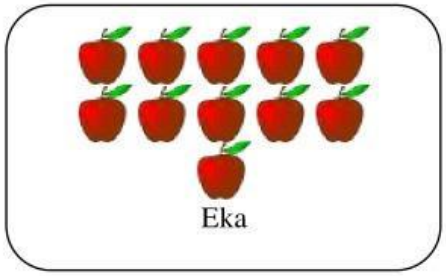

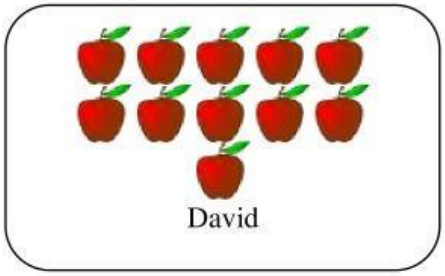

Jumlah apel Eka …
Jumlah apel David …
Apel Eka ……. apel David.

LIVEWORKSHEETS