Campbell Academy Foundation, Inc.
Asynchronous Activity in Numeracy
Lesson 17

What time is it?

Look at each clock. Click the time each shows.



3:00 | 2:00

10:00 | 8:00

6:00 | 7:00

5:00 | 2:00



3:00 | 9:00

11:00 | 12:00



4:00 | 2:00

3:00 | 1:00

10:00 | 12:00

LIVEWORKSHEETS

Draw a line and identify if the clock is an Analogue or Digital clock.

Analogue Clock	Digital Clock

LIVEWORKSHEETS