Fișă de lucru
Perimetrul

1. Realizează corespondența:

DREPTUNGHI	CERC	PĂTRAT	TRUNGHI

2. Bifează cu **X** varianta corectă:

Perimetrul pătratului=	Perimetrul dreptunghiului=
a)l+l+l+l=4xl	a)L+L+L+l+L
b) L+L	b) L+l+L+l= 2xl + 2xL
c) L-l	c)L+l

3. Calculați perimetrul următoarelor figuri geometrice:



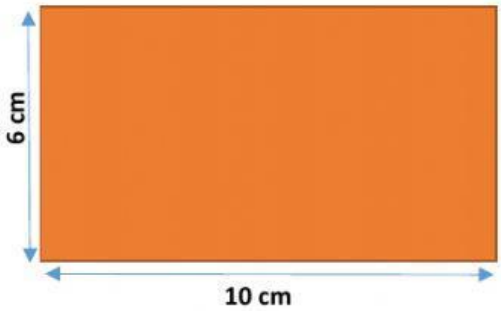

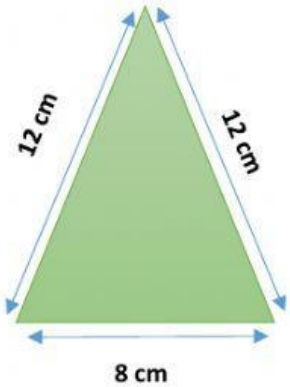

$P_{\square}$ =4xl	$P_{▬}$ =2xL + 2xl	$P_{\triangle}$ =12+8+
$P_{\square}$ =4x	$P_{▬}$ =2x10 + 2x	$P_{\triangle}$ =
$P_{\square}$ =	$P_{▬}$ =	$P_{\triangle}$ =

LIVEWORKSHEETS