PERIMETRO

1) PERIMETRO QUADRATO



$\ell \cdot 3$

2) PERIMETRO RETTANGOLO

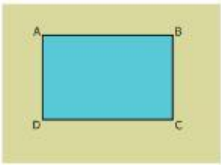

$\ell \cdot 4$

3) PERIMETRO ROMBO

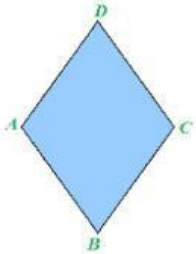

$B \cdot 2 + h \cdot 2$

4) PERIMETRO TRIANGOLO

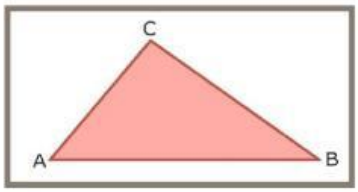

$\ell \cdot 4$

LIVEWORKSHEETS