UNIT : COORDINATES

The points **A** and **B** are shown on the grid.

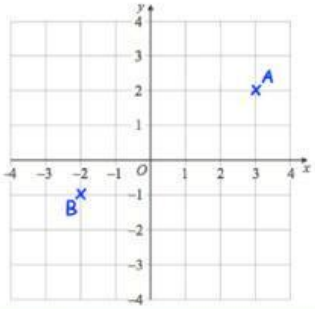

Write the coordinates of point **A**

(,)

Write the coordinates of point **B**

(,)

The points **A** and **B** are shown on the grid.

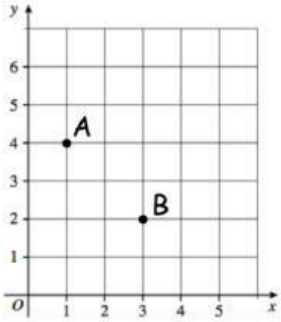

Write the coordinates of point **A**

(,)

Write the coordinates of point **B**

(,)

LIVEWORKSHEETS

A, **B**, **C** and **D** are the vertices of a rectangle.

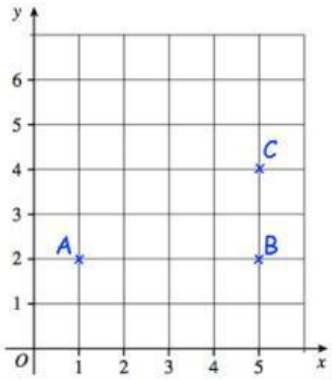

Write the coordinates of point **D**

(,)

A, **B** and **C** are the vertices of an isosceles triangle.

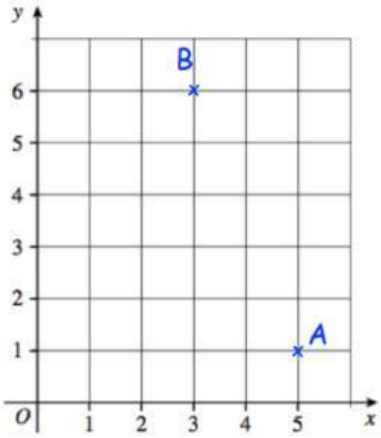

Write the coordinates of point ***C***

(,)

LIVEWORKSHEETS

A, **B**, **C** and **D** are the vertices of a kite.

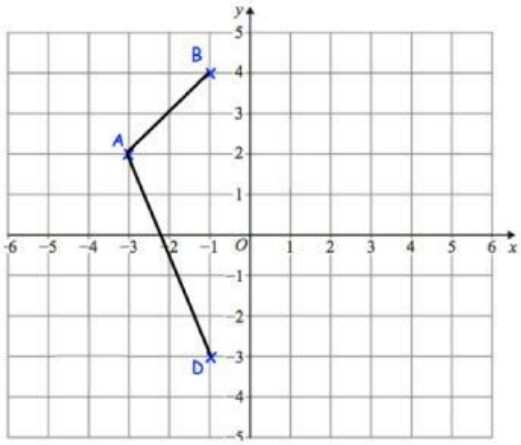

Write the coordinates of point ***C***

(,)

Here is one side of a square drawn on a coordinate grid.

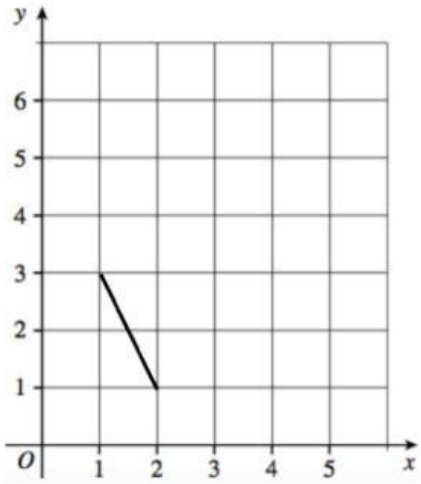

The square has a vertex at (3, 4)

Write other three coordinates of square ?

LIVEWORKSHEETS

Here is a square on coordinate axes

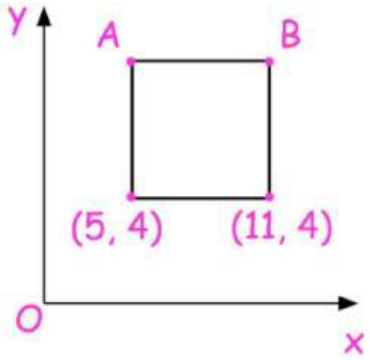

Not to scale

Write the coordinates of points **A** and **B**

A = (,)

B = (,)

The diagram shows two identical squares.

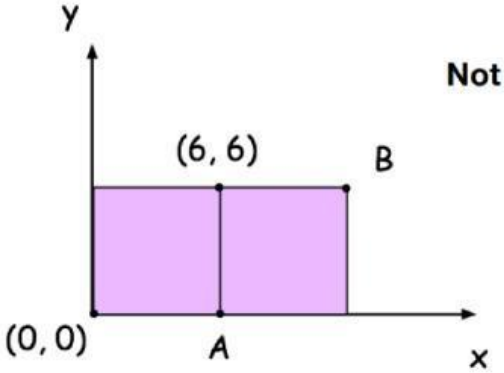

Not to scale

Write the coordinates of points **A** and **B**

A = (,)

B = (,)

LIVEWORKSHEETS

The diagram shows a square on coordinate axes.

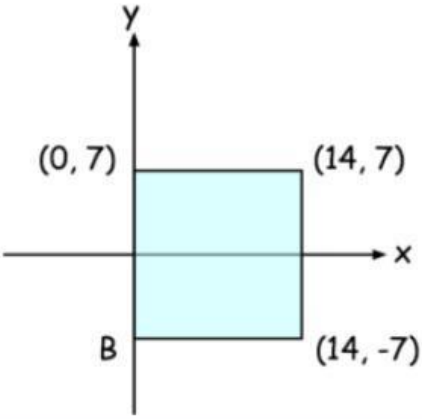

Not to scale

Write the coordinates of point **B**

(,)

In this diagram **M** is an equal distance from **A** and **B**

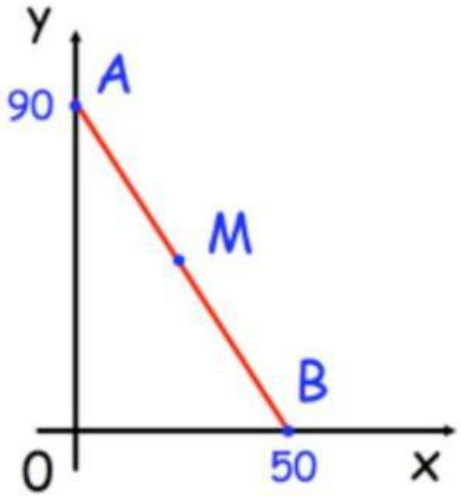

Not to scale

What are the coordinates of **M**? (,)

LIVEWORKSHEETS

In this diagram **M** is an equal distance from **P** and **Q**

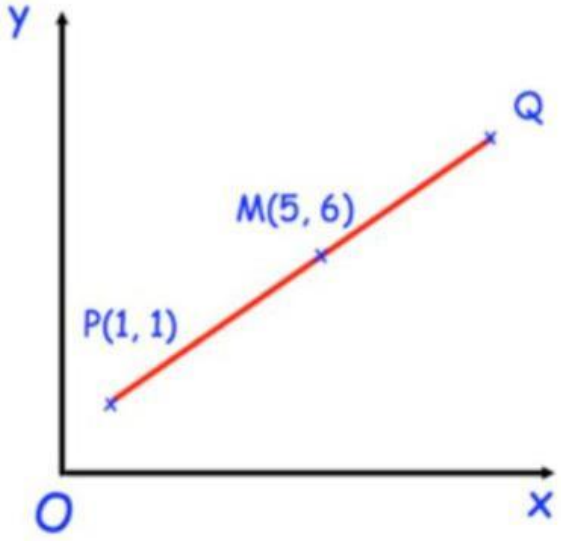

What are the coordinates of **Q**? (,)

LIVEWORKSHEETS