AYO MENCOBA

TENTUKAN LUAS DAERAH BERIKUT DENGAN CERMAT.

pindai barcode untuk mengerjakan soal !



(A)



(B)

Perhatikan bahwa:

1 cm



1 cm

TULIS JAWABANMU DISINI

LUAS (A) =

LUAS (B) +

UNTUK MEMBANTU PENGUATAN PEMAHAMAN. KALIAN BISA TONTON VIDEO DI BAWAH INI.

LIVEWORKSHEETS