# Math – More, Less and Equal

Read the sentence and answer the question.

| | |
|---|---|
| Which cup has more?<br>  | Which bowl has less?<br> |
| Are these equal?<br>  <br>Yes No | Which group has more?<br> |
| Are these equal?<br> 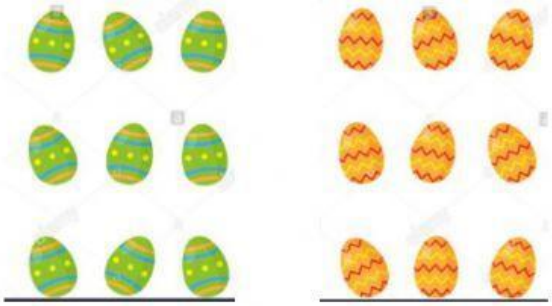 <br>Yes No | Which group has less?<br> |

LIVEWORKSHEETS

Which group has less?

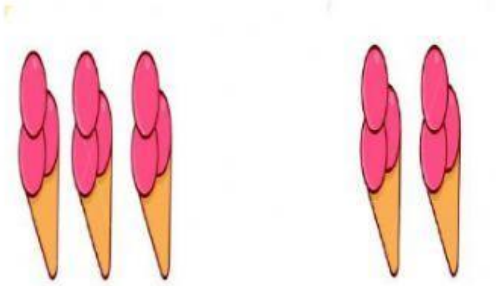

Are these equal?

**Yes** **No**

Which group has more?



Which group has less?

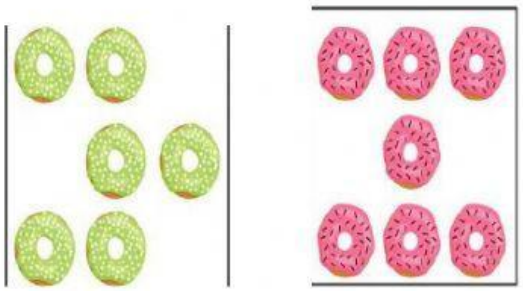

Are these equal?

**Yes** **No**

Which group has more?



LIVEWORKSHEETS