Өртөө -2 /цахим/

1. Тойргийн хэсгүүдийг тодорхойл.

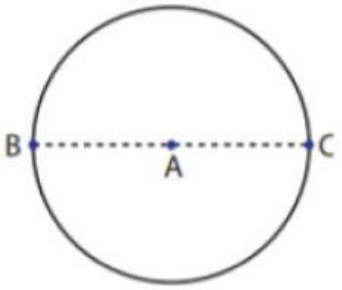

Төв: _____

Радиус:____

Диаметр:___

2. Мэдэгдэхгүй байгаа өнцгийг ол.

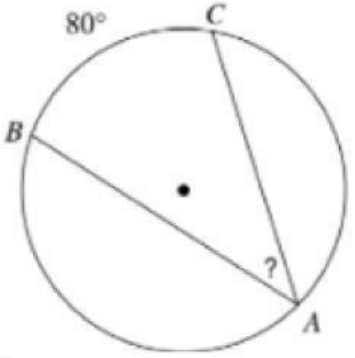

x = _____

3. Мэдэгдэхгүй байгаа нумыг ол.

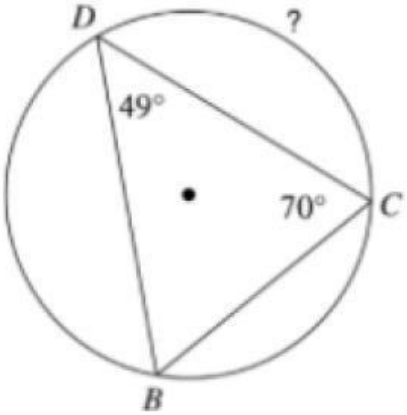

x = _____

4. Мэдэгдэхгүй байгаа өнцгийг ол.

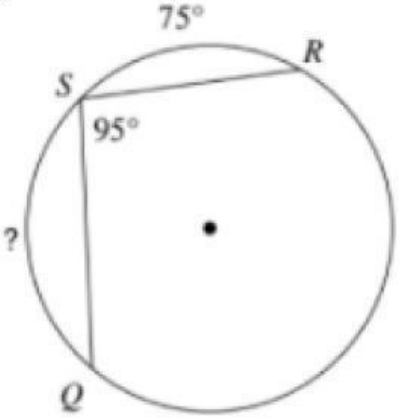

x = _____

LIVEWORKSHEETS