Decimals: Tenths and Hundredths

Write decimals. One has been done for you.

a.

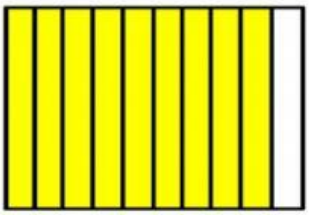

b.



c.

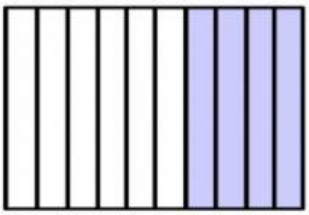

d.

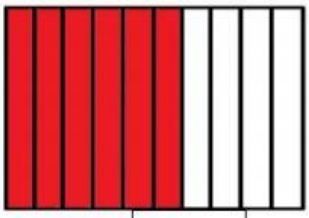

e.

f.







g.



h.

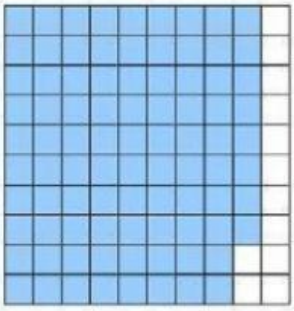

i.

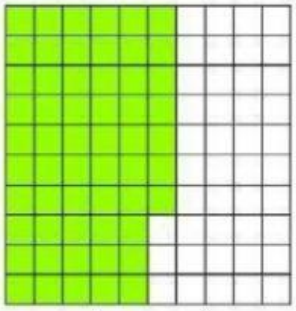

j.













LIVEWORKSHEETS

Write the decimals.

6 tenths ☐

2 units 7 tenths ☐

1 ten 3 units 5 tenths ☐

7 hundredths ☐

53 hundredths ☐

3 tens 4 units 13 hundredths ☐

Write the Place value of the underlined digits in each number.

23.4_____

54.74 _____

89.65_____

3.33_____

46.71 _____

92.34 _____

32.63 _____

Write the missing decimals.

1+0.3+0.05=_____

2+0.6+ _____ =2.64

10.74= 10+ _____+0.04

5+ _____+0.08=5.68

30+3+0.3+0.03=_____

Write the decimals which you see on the abacus.

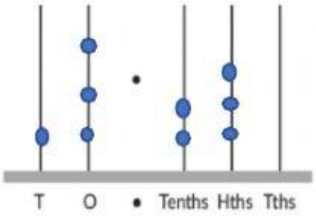

☐

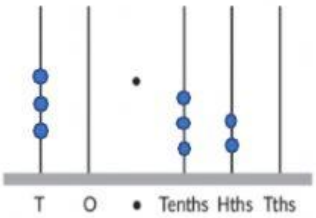

☐

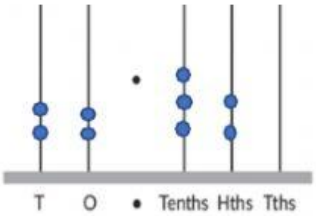

☐

LIVEWORKSHEETS