هر کدام از شکل های زیر را چند درجه بچرخانیم تا روی خودش منطبق شود؟ (در کادر بنویس).

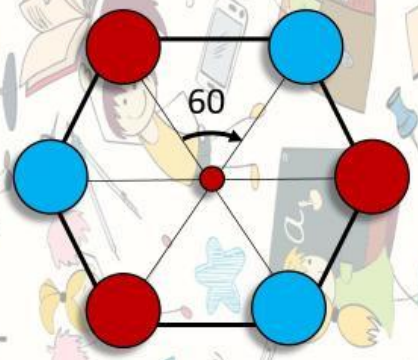

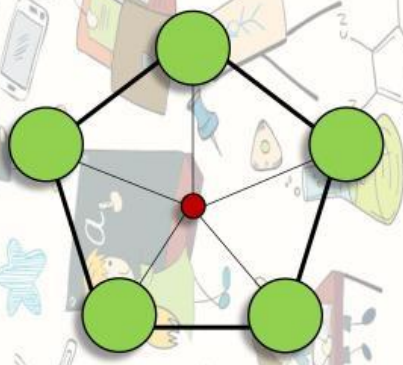

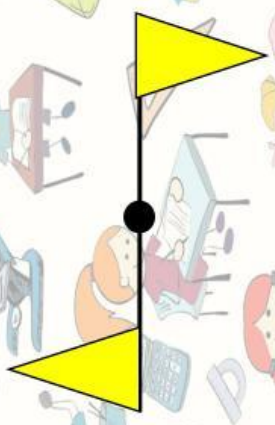

LIVEWORKSHEETS