Campbell Academy Foundation, Inc.

Lower Calajo-an, Minglanilla Cebu

Weekly Test in K2 Numeracy

Lesson 12

Prepared by: Ms. Love

Name : _____

_____

_____

Listen to your teacher as she read the questions. Choose the letter of your answer.

1.Which symbol is used for addition?

A. - B. + C. =

2. What does the word "**take away**" mean?

A. Add B. Subtract C. Equal

3. If you count all the numbers of objects together, What are you doing?

A. Adding (+) B. Taking away (-) C. Making it smaller

4. What is a word problem?

A. A sentence that tells a number story and asks a question.

B. A list of numbers to be spelled.

C. A number of objects that need to count.

5. Joey was walking with 3 dogs in the park, Kean is also walking in the park with his 2 dogs. Who has 3 dogs?

A. Joey B. Kean C. Both of them

LIVEWORKSHEETS



6. Abbie had a box of 9 crayons. There 5 crayons rolled away. How many crayons are left with Abbie?

A. 5 crayons B. 6 crayons C. 4 crayons

7. Dave and Mia were playing with their toys. Dave has 3 toys and Mia has 4 toys. How many toys do they have altogether?

A. 8 toys

B. 7 toys

C. 9 toys

8. Luke has a bag of 6 baseballs. He threw 4 of them. How many baseballs are left?

A. 2 baseballs B. 3 baseballs C. 10 baseballs

9. Ted had 5 candies. Her mom gave her 3 more candies. So Ted has 7 candies in all. Which is the correct number sentence in the problem?

A. 5+3= 8 B. 5+2= 7 C. 5-2=7

10. Mina has 10 fruits in the basket. She gave 7 fruits to her classmates. How many fruits are left?

A. 8 fruits B. 3 fruits C. 2 fruits

LIVEWORKSHEETS

Read each word problem below and write the number sentence in the box.

Sarah has 2 apples. Her friend gives her 3 more apples. How many apples does Sarah have now?

☐ + ☐ = ☐

Tim has 1 blue balloon and 4 red balloons. How many balloons does Tim have in total?

☐ + ☐ = ☐

There are 5 birds sitting on a fence. 2 more birds join them. How many birds are there now?



☐ + ☐ = ☐

Emma sees 3 butterflies in the garden. Later, she sees 2 more butterflies. How many butterflies does Emma see in total?

☐ + ☐ = ☐

LIVEWORKSHEETS

Max has 4 shells. He gives 2 shells to his brother. How many shells does Max have now?



☐ - ☐ = ☐

Anna has 3 candies. She eats 1 candy. How many candies does Anna have left?



☐ - ☐ = ☐

Peter sees 6 squirrels in the park. 3 squirrels run away. How many squirrels are left?

☐ - ☐ = ☐

Daisy has 5 toy trains. She loses 2 toy trains. How many toy trains does Daisy have now?

☐ - ☐ = ☐

Bonus Points:

The fish tank has **9 blue fish** inside. The cat took away **8 fish**. How many fish are **left** in the tank? (Write the number sentence below)

☐ ○ ☐ ○ ☐

LIVEWORKSHEETS