Прізвище та ім'я_____ Клас_____ Дата_____

Ознаки рівності трикутників

Знайдіть значення x

1)

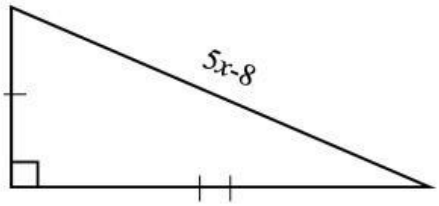

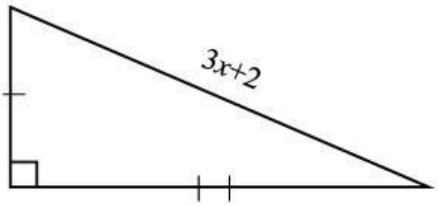

x=_____

2)

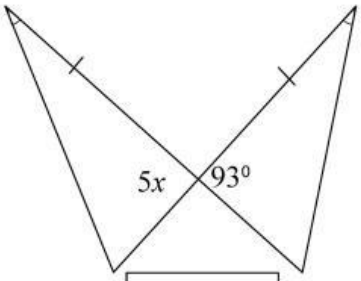

x=_____

3)

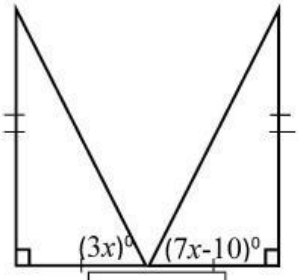

x=_____

4)

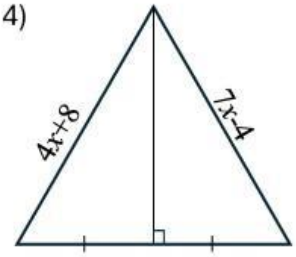

x=_____

5)

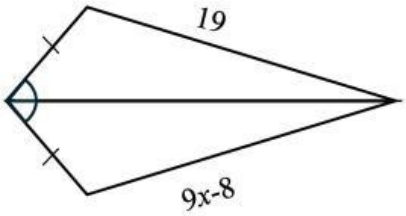

x=_____

6)

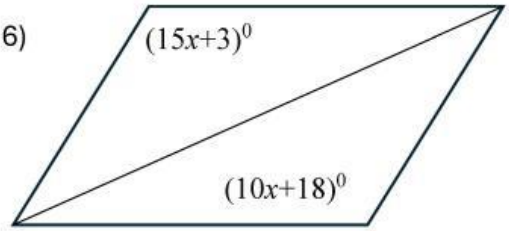

x=_____

7)

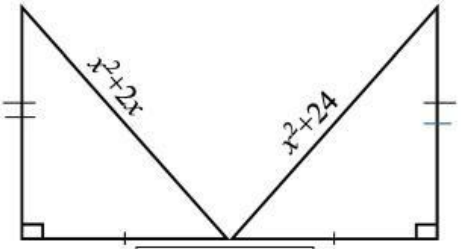

x=_____

LIVEWORKSHEETS