ANGOLI ESPLEMENTARI

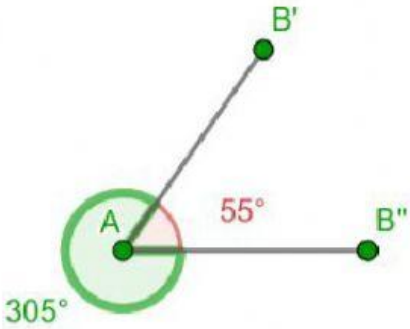

55° + 305° = 360°

Due ANGOLI sono **ESPLEMENTARI** se la loro somma è un **ANGOLO GIRO**

SE **α = 55°**
β = 360° - 55° = 305°

Determina l'ampiezza dell'angolo esplementare a quello dato:

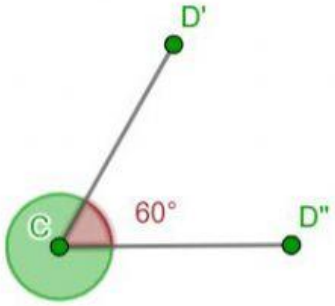

SE **α** = 60°

β = 360° - ° = °

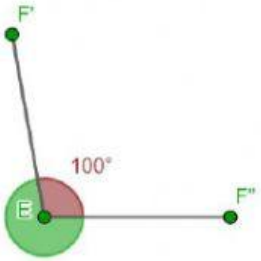

SE **α** = 100°

β = ° - ° = °

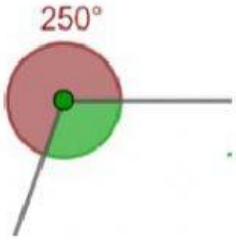

SE **α** = 250°

β = ° - ° = °

LIVEWORKSHEETS