ANGOLI SUPPLEMENTARI

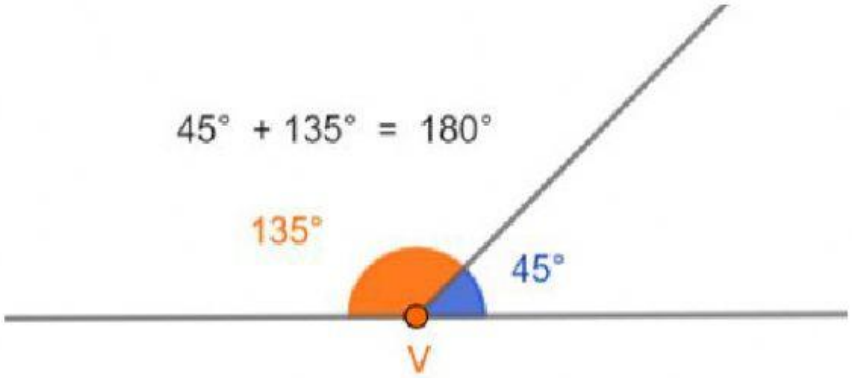

Due ANGOLI sono **SUPPLEMENTARI** se la loro somma è un **ANGOLO PIATTO**

SE **α** = 45°
β = 180° - 45° = 135°

Determina l'ampiezza dell'angolo supplementare a quello dato:

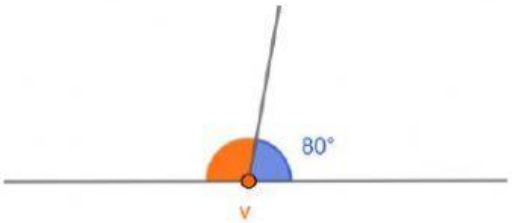

SE **α** = 80°

β = 180° - ° = °

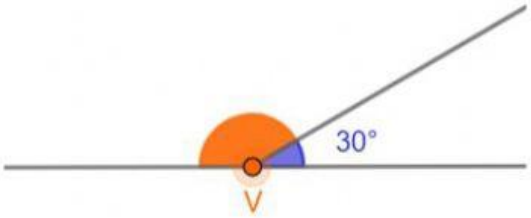

SE **α** = 30°

β = ° - ° = °

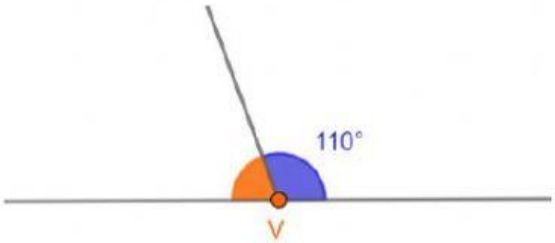

SE **α** = 110°

β = ° - ° = °

LIVEWORKSHEETS