Find the Ratios



What is the ratio of ● to ♥ ? = ____ : ____ Simplified = ____ : ____

What is the ratio of ♥ to (● + ♥) ? = ____ : ____ = ____ : ____



What is the ratio of ◆ to ✚ ? = ____ : ____ Simplified = ____ : ____

What is the ratio of ✚ to (◆ + ✚) ? = ____ : ____ = ____ : ____

What is the ratio of △ to ★ ? = ____ : ____ Simplified = ____ : ____

What is the ratio of ★ to (△ + ★) ? = ____ : ____ = ____ : ____



What is the ratio of ★ to ● ? = ____ : ____ Simplified = ____ : ____

What is the ratio of ● to (★ + ●) ? = ____ : ____ = ____ : ____

LIVEWORKSHEETS