Nama :

Tanggal :

Mari belajar menghitung!

Hitunglah ada berapa banyak kendaraan di dalam tabel berikut!



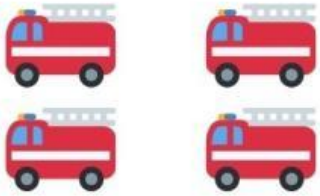

LIVEWORKSHEETS

Berikan jawaban yang benar dari penjumlahan di bawah ini!

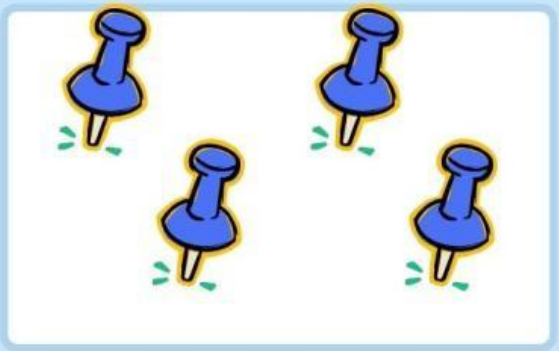

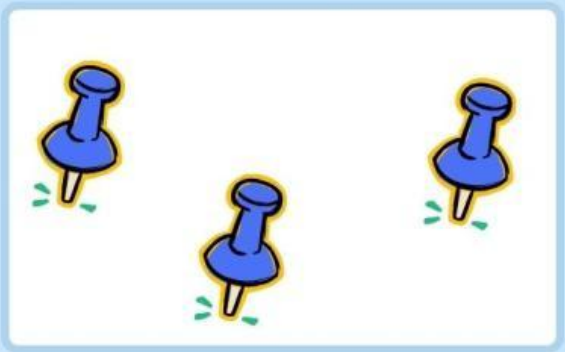

4 + 3 =.....



2 + 1 = ...





7 + 3 =....

LIVEWORKSHEETS