Lembar Kerja Peserta Didik

LKPD

MATEMATIKA SD 1

Disusun oleh : Fika Fitria

LIVEWORKSHEETS

TULISLAH BERAPA BANYAK ALAT TRANSPORRTASI

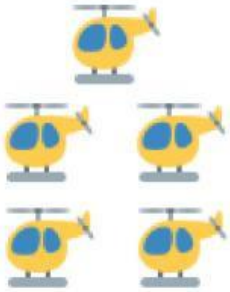

5



.....



.....



.....

.....

.....

.....

.....

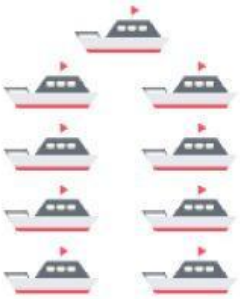

.....

LIVEWORKSHEETS

Mari Berhitung

Berapa jumlah buah - buahan di bawah ini ?



LIVEWORKSHEETS

bilangan 1- 20

1	2	___	4
5	___	7	___
___	10	___	12
13	___	___	16
17	___	19	___

LIVEWORKSHEETS

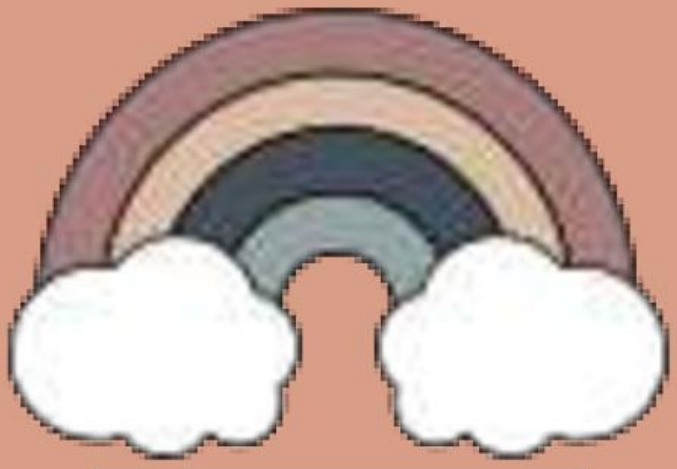

mencocokkan

1	satu
10	sepuluh
9	dua
7	tujuh
2	sembilan

LIVEWORKSHEETS