Lembar Kerja Peserta Didik

LKPD

MATEMATIKA

Operasi Hitung Penjumlahan dan Pengurangan

Disusun oleh : Fika Fitria

LIVEWORKSHEETS

POKOK PEMBELAJARAN

- Bilangan
  - Menghitung
  - Membaca
  - Menulis Bilangan
  - Menghitung jumlah
  - mengisi titik-titik
  - Menghitung Maju
  - Menghitung Mundur

LIVEWORKSHEETS

1

SATU

6

ENAM



2

DUA

7

TUJUH

3

TIGA



8

DELAPAN

4

EMPAT

9

SEMBILAN

5

LIMA

10

SEPULUH



LIVEWORKSHEETS

TULISLAH BERAPA BANYAK ALAT TRANSPORRTASI

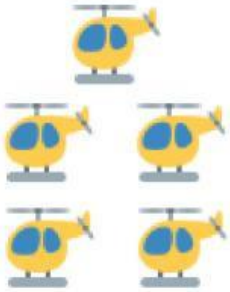

5



.....



.....



.....

.....

.....

.....

.....

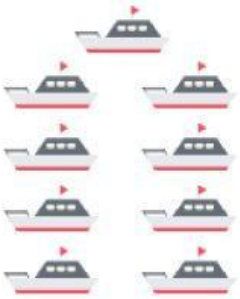

.....

LIVEWORKSHEETS

Mari Berhitung

Berapa jumlah buah - buahan di bawah ini ?



LIVEWORKSHEETS

bilangan 1- 20

1	2	___	4
5	___	7	___
___	10	___	12
13	___	___	16
17	___	19	___

LIVEWORKSHEETS

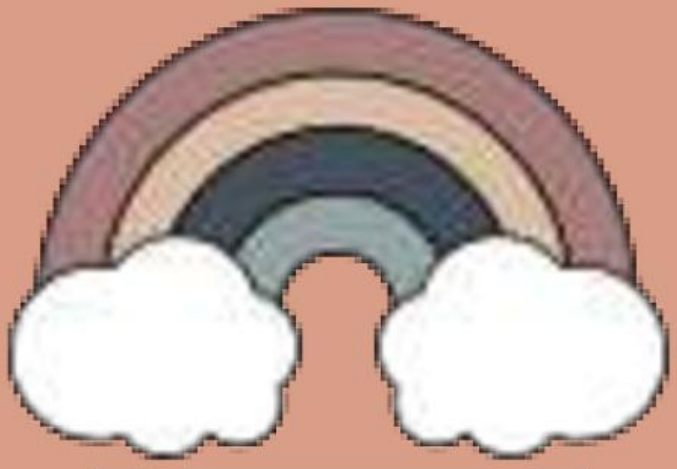

angka sesudah

1	
10	
15	
20	
25	

LIVEWORKSHEETS

angka sebelum

	9
	11
	16
	22
	17

LIVEWORKSHEETS